דלתון

תרגיל 1:

- בסרטוטים שלפניכם כמה דלתונים .קבעו את הערכים של ix. y -

א

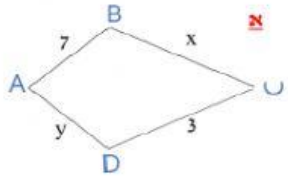

X: _____

Y: _____

ב

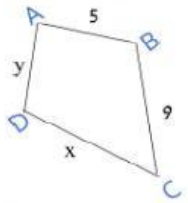

X: _____

Y: _____

ג

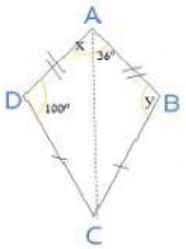

X: _____

Y: _____

תרגיל 2:

המרובע ABCD הוא דלתון (BC =DC ; BA = DA)

נתון:

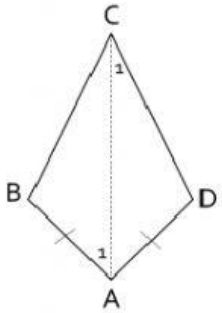

∢BCD= 60

∢BAD=100

חשבו:

$\sphericalangle C_1 =$

$\sphericalangle A_1 =$

∢ B=

$\sphericalangle D =$

תרגיל 3:

המרובע ABCD הוא דלתון (BC =DC ; BA = DA)

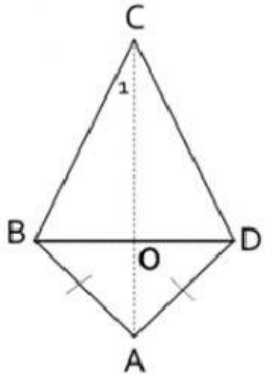

נתון:

BD= 14 ס"מ

∢B= 110

∢C1=25

חשבו:

OD =

OB =

∢ D=

$\sphericalangle C =$