less than

Comparing Groups of Numbers

Activity 2

more than

Name: _____

1. Complete the number sentence and say which is more than or less than, example:



6 – 3 = 3

3 is less than 6

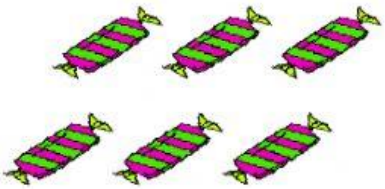

2.

8 – 2 = 6



2 is ____ than 8

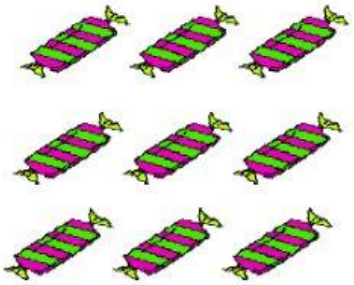

3.

8 – 4 = 4



8 is____ than 4



4.

10 - 5 = 5





10 is_____ than 5

5.

8 - 4 = 4



4 is _____than 8



6.

9 - 3 = 6



3 is_____ than 9

