UNE CADA OPERACIÓN CON LA REPRESENTACIÓN CORRESPONDIENTE

$\frac{1}{8} + \frac{6}{8}$

$\frac{3}{2} - \frac{2}{2}$

$\frac{5}{10} + \frac{3}{10}$
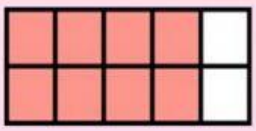
$\frac{9}{6} - \frac{6}{6}$