Idatzi lauki bakoitzean dagokion letra

A	OSAGARRIAK
B	BETEGARRIAK
C	ONDOZ ONDOKOAK
D	AUZOKIDEAK
E	ERPINETIK AURKAKOAK

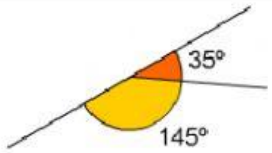

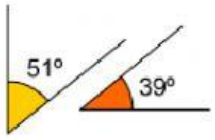

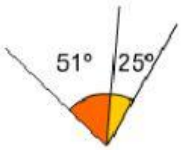

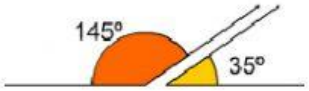

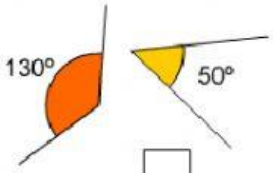

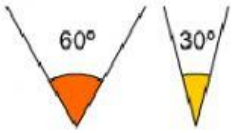

Zirkunferentzia honen atal bakoitzaren izena jar ezazu:

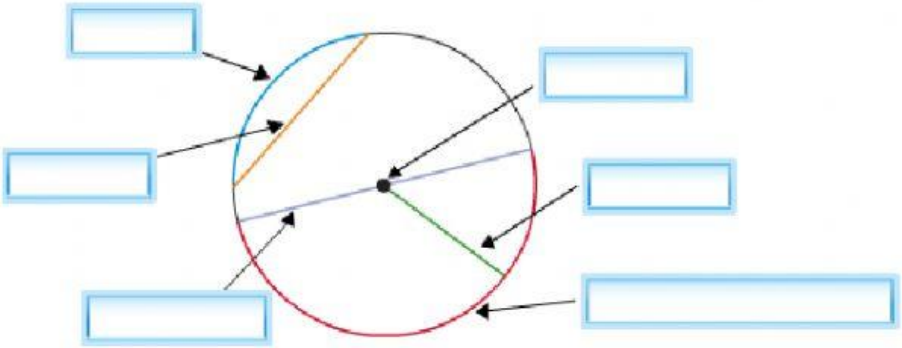

Adierazi eskatzen zaizun unitatean:

2,4 km =		m	0,7 kl =		ℓ	0,5 kg =		g
0,9 hm =		m	2,5 hl =		ℓ	1,6 hg =		g
3,78 dam =		m	0,56 dal =		ℓ	0,43 dag =		g
3,5 dm =		m	32,1 dl =		ℓ	12,9 dg =		g
94 cm =		m	4,5 cl =		ℓ	0,7 cg =		g
232 mm =		m	94,3 ml =		ℓ	4,3 mg =		g

Egin hurrengo unitate aldaketa:

265 min= h min

12497 s= h min s

1h 34 min 48 s= s

3h 19 min 24 s= s

Osatu laukiak dagokion erantzunez:

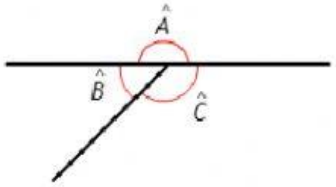

- $\hat{A}$ ▷ ☐ $\hat{B}$ ▷ ☐ $\hat{C}$ ▷ ☐

$\hat{A}$ y $\hat{B}$ son ☐

$\hat{B}$ y $\hat{C}$ son ☐

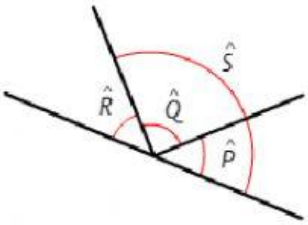

- $\hat{P}$ ▷ ☐ $\hat{Q}$ ▷ ☐

$\hat{S}$ ▷ ☐ $\hat{R}$ ▷ ☐

$\hat{S}$ y $\hat{R}$ son ☐

$\hat{P}$ y $\hat{Q}$ son ☐

Kalkulatu hurrengo angeluen neurriak:

ANGELUA	OSAGARRIEN NEURRIA	BETEGARRIEN NEURRIA
30º	☐º 30º	☐º 30º
53º	53º ☐º	53º ☐º
76º	76º ☐º	76º ☐º
115º		115º ☐º
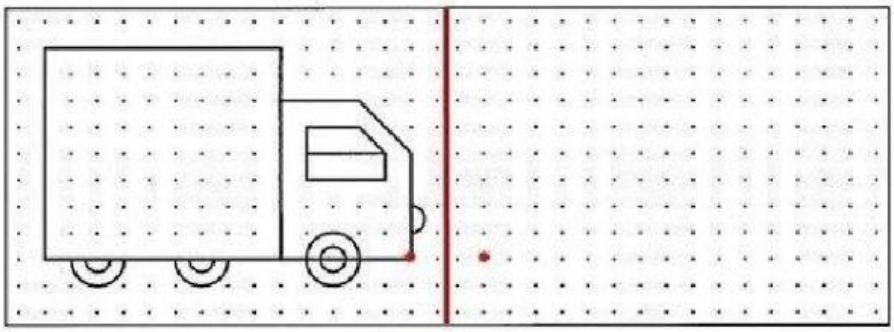
Marraztu marrazki bakoitzaren irudi simetrikoa: