Identify the number of **H**undreds, **T**ens, and **O**nes, then write the number. Complete also the expanded form. See sample:

1)

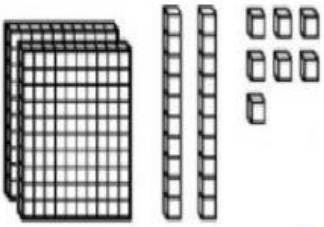

H= 2 T= 2 O= 7

Number = 227

200 + 20 + 7 = 227

2)

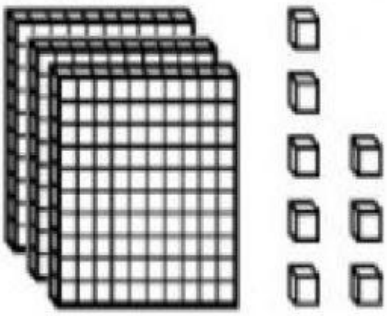

H= T= O=

Number =

+ + =

3)

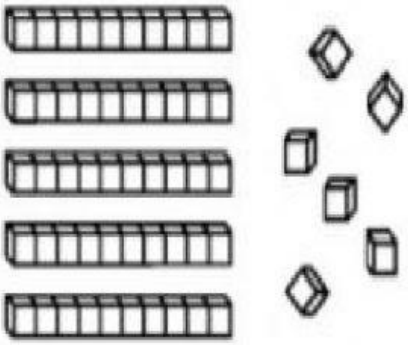

H= T= O=

Number =

+ + =

4)

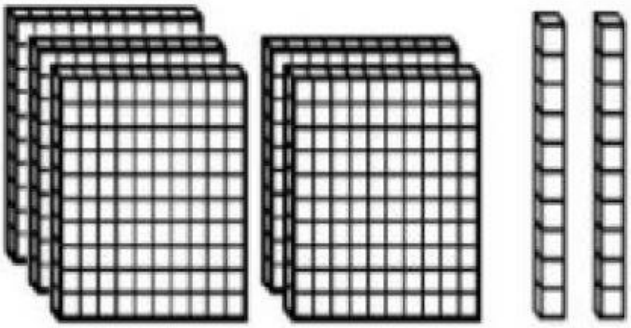

H= T= O=

Number =

+ + =