5.ఎంత ఎక్కువ - ఎంత తక్కువ? Name -

How much more - How much less?

Class:- IV

Subject:- Maths

Solve the following on the beads chain in whichever way you want and state the sum and also write.

పూసలదండను ఉపయోగించి, కింది సమస్యలను మీ ఇష్టమైన పద్ధతిలో కూడి మొత్తాన్ని కనుగొనండి.

ప్రతి రంగులో 10 పూసలు ఉంటాయి.

1. 34 + 16 =

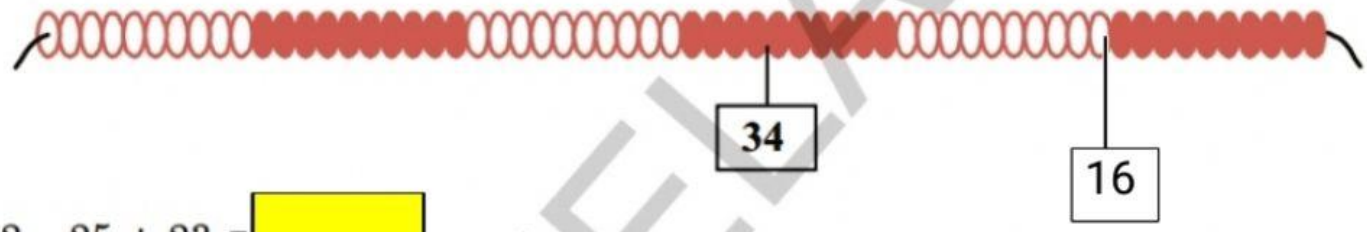

2. 25 + 23 =

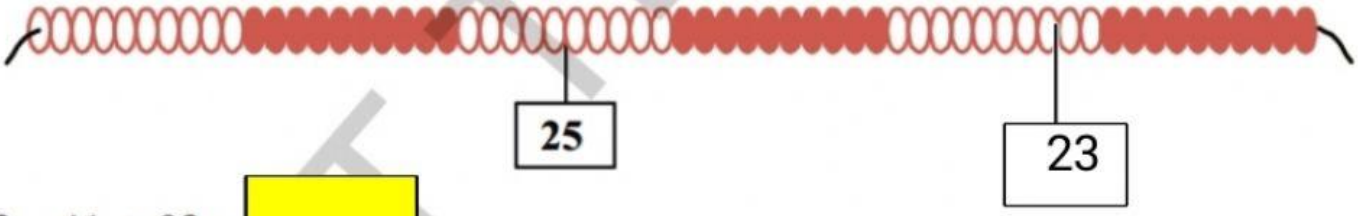

3. 41 + 23 =



4. 53 + 12 =

5. 20 + 10 =

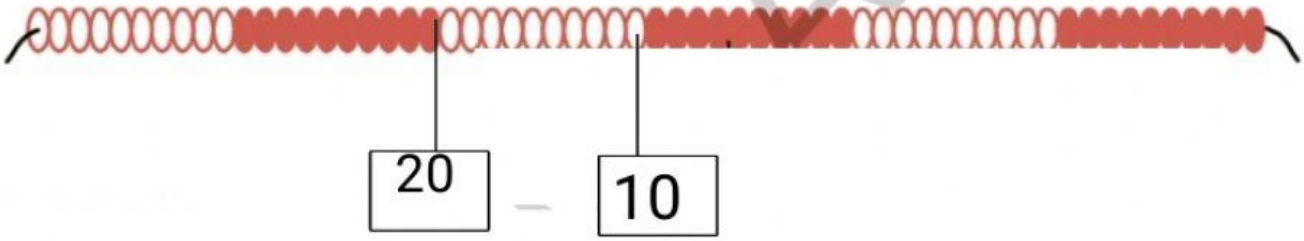

SCERT TELANGANA