Determining Value with Blocks

Name:

Find the value each set of blocks represents.

1) 

2) 

3) 

4)

5) 

6) 

7) 

8) 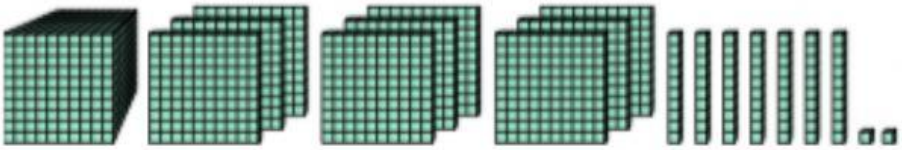

9) 

10)

Answers

1. _____
2. _____
3. _____
4. _____
5. _____
6. _____
7. _____
8. _____
9. _____
10. _____