Hands On
Multiply with Arrays

Write an addition sentence and a multiplication sentence to show equal rows.

6. 

___ + ___ + ___ + ___ = ___

___ × ___ = ___

7. 

___ + ___ + ___ = ___

___ × ___ = ___

8. 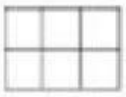

___ + ___ = ___

___ × ___ = ___

9. Use the Commutative Property of Multiplication to write another multiplication sentence for Exercise 8.

___ × ___ = ___