Geometry Quiz

PART 1: Name That 2D or 3D Shape! Drag the names below to match the correct shape.

Sphere	Rectangle	Pentagon	Pyramid
Rectangular Prism	Octagon	Cone	Parallelogram

_____

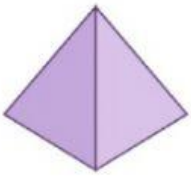

_____

_____

_____

_____

_____

_____



_____

PART 2: Match the shape to its net.

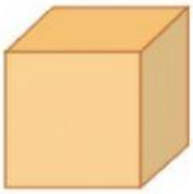

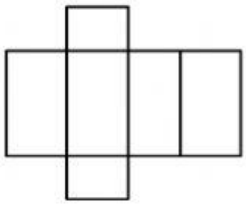

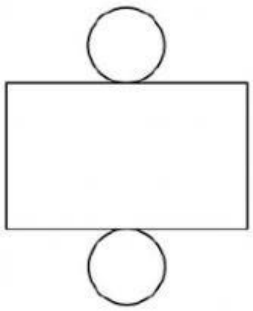



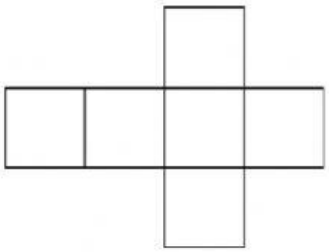

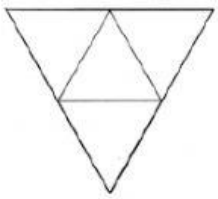

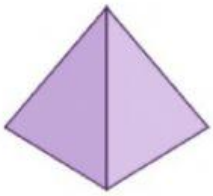

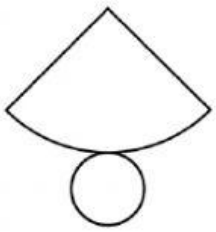

PART 3: Faces, Edges and Vertices! Write down how many faces, edges and vertices each shape has!

SHAPES	NUMBER OF FACES	NUMBER OF EDGES	NUMBER OF VERTICES
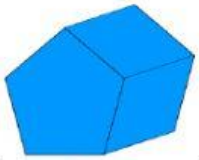			
			

PART 4: Properties of rectangles!

1) A rectangle has _____ right angles.

2) A rectangle has _____ lines of symmetry.

3) Opposite sides of a rectangle are _____ and _____.

4) All rectangles have _____ sides and _____ vertices.

5)

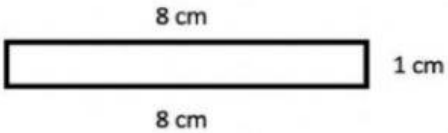

Missing side: _____ cm

6)

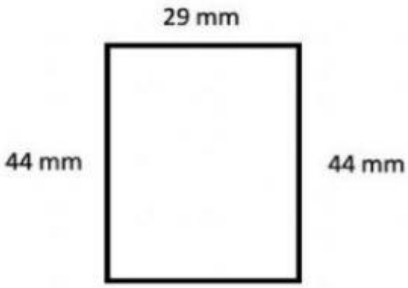

Missing side: _____ mm