Name:..... Date:.....

Complete each fact family.

4.

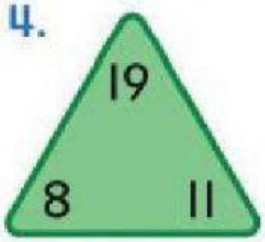

___ + ___ = ___ ___ − ___ = ___

___ + ___ = ___ ___ − ___ = ___

5.

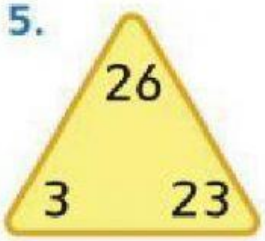

___ + ___ = ___ ___ − ___ = ___

___ + ___ = ___ ___ − ___ = ___

6.

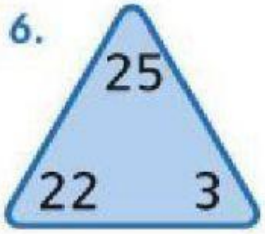

___ + ___ = ___ ___ − ___ = ___

___ + ___ = ___ ___ − ___ = ___