Look over the **pictograph**: Votes for Class Pet
Answer the questions!

Votes for Class Pet

bunny						
Guinea pig						
fish						

Key: one picture= 1 vote

1)What is the title of the graph?	Votes for Class Pet	Class Pets	Pets we do not want
2) How many voted for fish?	1	5	2
3) How many voted for guinea pig?	5	6	4
4) How many voted for bunny?	5	2	4
5) How many voted total? (count up every picture to help you figure it out!)	12	11	10
6) How many voted for guinea pig and bunny altogether? (add the guinea pig and bunny together!)	10	4	9

Look over the **pictograph**: Votes for Class Pet
Answer the questions!