Fracciones equivalentes

1) Escribí el numerador que falta en estas fracciones equivalentes.

A-

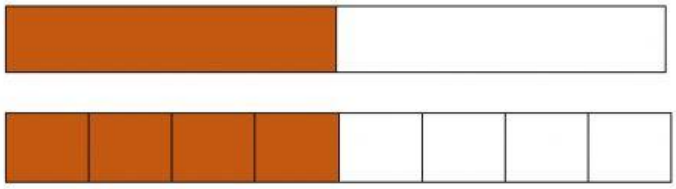

$$\frac{1}{2} = \frac{\square}{8}$$

B-

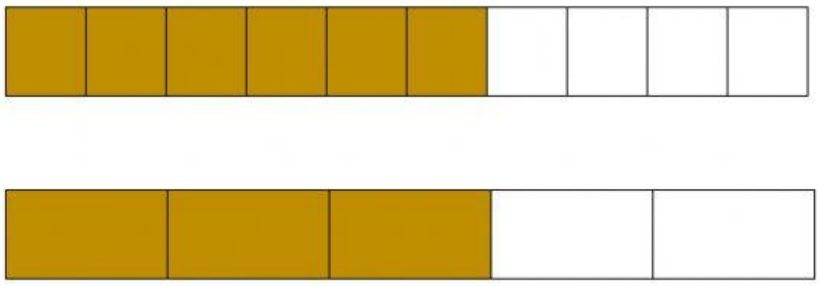

$$\frac{6}{10} = \frac{\square}{5}$$

2) Escribí el denominador que falta en estas fracciones equivalentes.

A-

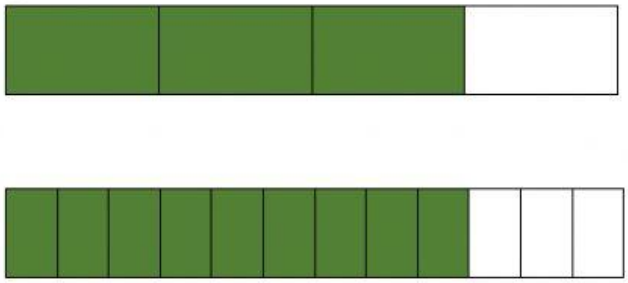

$$\frac{3}{4} = \frac{9}{\square}$$

B-

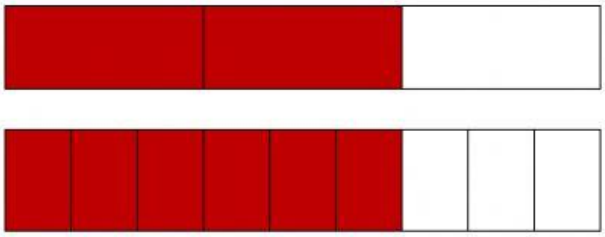

$$\frac{2}{3} = \frac{6}{\square}$$

3) Escribí la fracción equivalente en cada ejercicio.

A-

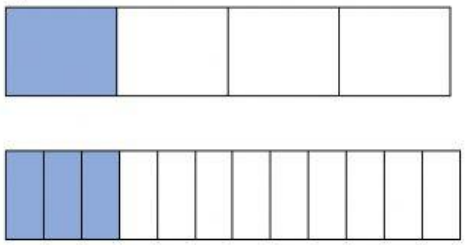

$$\frac{1}{4} = \frac{\square}{\square}$$

B-

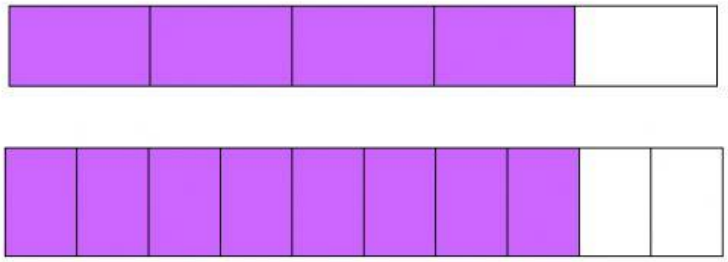

$$\frac{4}{5} = \frac{\square}{\square}$$

C-

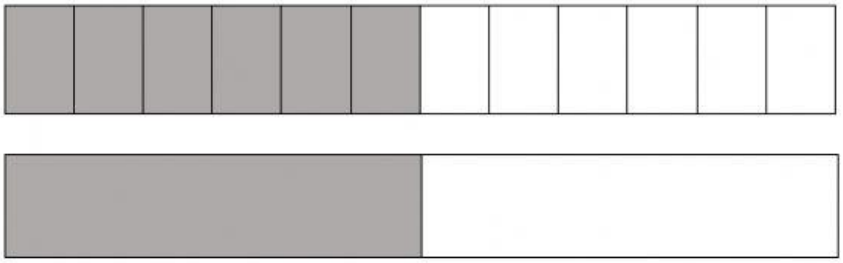

$$\frac{6}{12} = \frac{\square}{\square}$$

D-

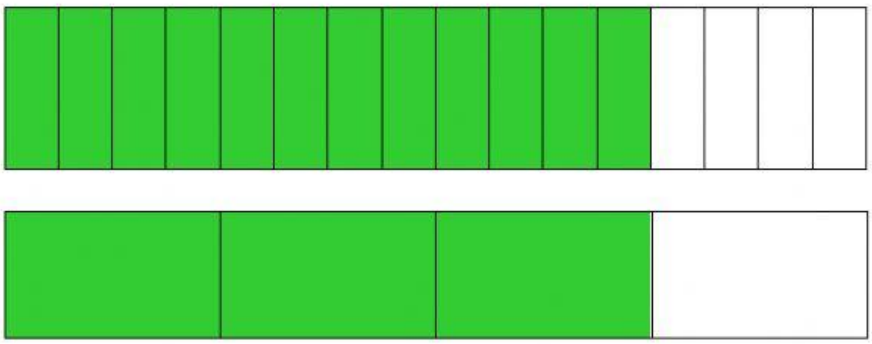

$$\frac{12}{16} = \frac{\square}{\square}$$