COMPRAMOS CARAMELOS







¿CUÁNTOS CARAMELOS HAY EN TOTAL EN TODAS LAS BOLSAS?
¿TE ANIMÁS A CONTARLOS? LUEGO, ESCRIBÍ EL NÚMERO: