Q1. Count the number of sides and mark the angles in the following figures.

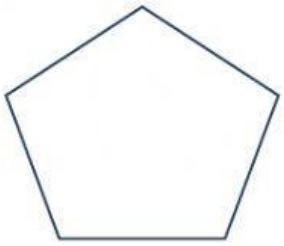

Number of sides = …….

Number of angles = ……..…….

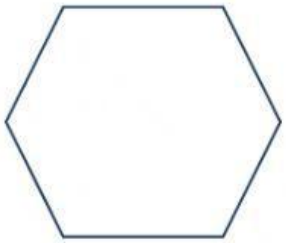

Number of sides = …….

Number of angles = ……..…….

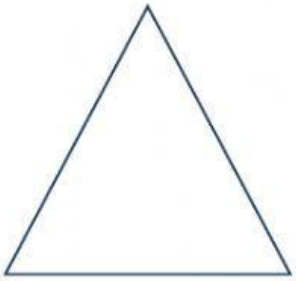

Number of sides = …….

Number of angles = ……..…….



Number of sides = …….

Number of angles = ……..…….

Number of sides = …….

Number of angles = ……..……