WORKSHEET-1

CLASS – V - MATHS

CHAP-2 -SHAPES AND ANGLES

Endpoints, Line Segments and Angles

Most shapes have endpoints, line segments and angles.

Finish the chart by counting the endpoints, line segments and angles.

Shape	Number of Endpoints	Number of Line Segments	Number of Angles
square			
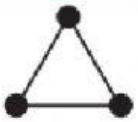 triangle			
 rectangle			
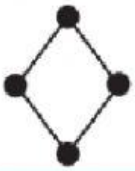 diamond			
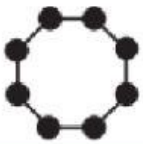 octagon			

WORKSHEET-2

CHAP-2-SHAPES AND ANGLES

MARK THE RIGHT ANGLES IN THE GIVEN SHAPE BELOW

Identifying Right Angles on Shapes

Label any right angles on the following shapes.
Use the corner of your ruler to check.

a)

b)

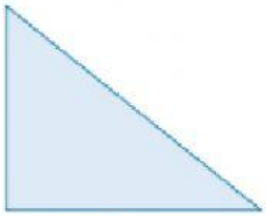

c)

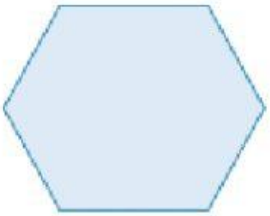

d)

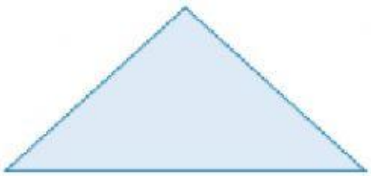

e)
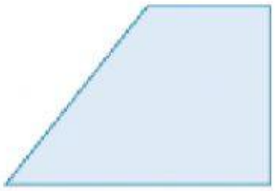
f)