Exit Task (Exterior angles of a triangle)

Grade 7 _ (04.10.2020)

Instructions: Attempt all the questions.
Write numerical values only.

Must Know:



$x =$ °

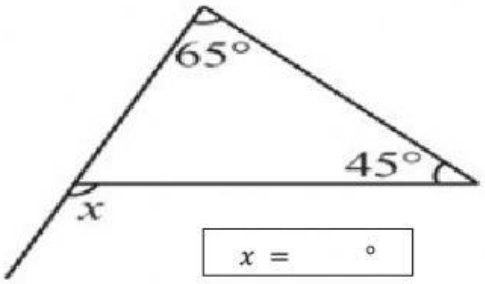

$x =$ °

Good to Know:

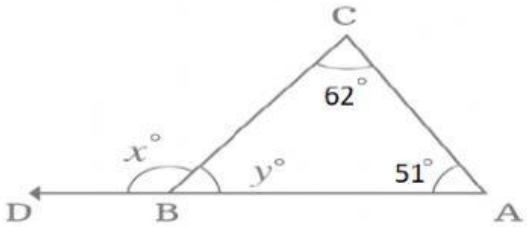

$x =$ °

$y =$ °

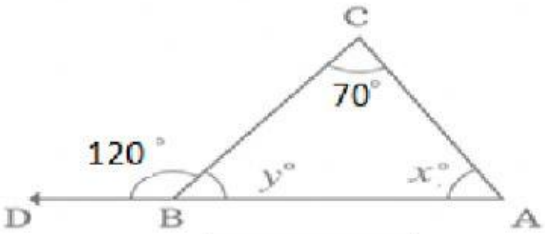

$x =$ °

$y =$ °

Fun to Know:

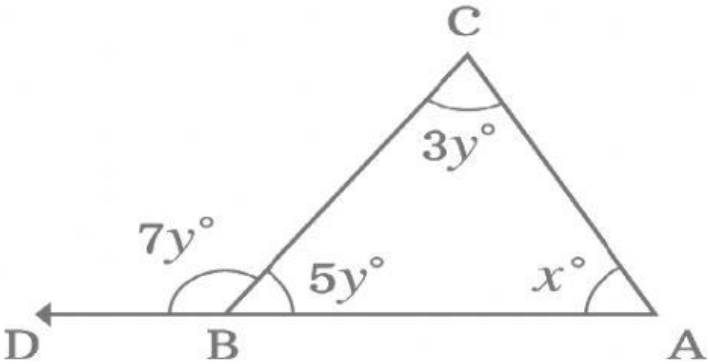

$x =$ °

$y =$ °

$\angle A =$ °

$\angle B =$ °

$\angle C =$ °

$exterior\ \angle B =$ °