Prismas y Pirámides

Ubique el nombre de los siguientes prismas

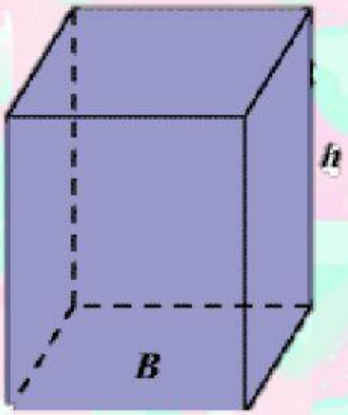

Prisma Cuadrangular

Pirámide Hexagonal

Prisma Triangular

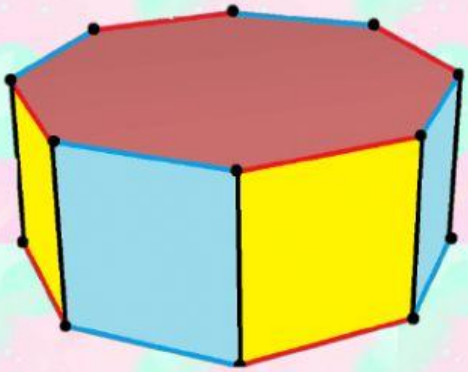

Prisma Decagonal

Prisma Triangular

Prisma Octagonal

LO HICISTE BIEN SIGUE ASI

Ubique el nombre de las siguientes pirámides

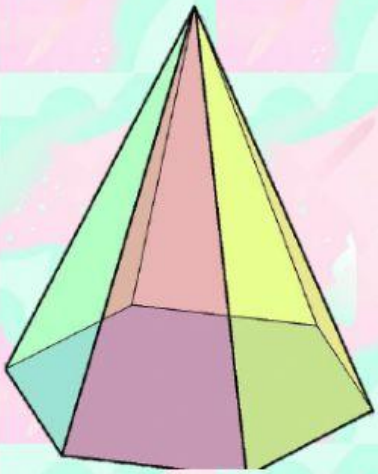

Prisma Decagonal

Pirámide Hexagonal

Pirámide Octagonal

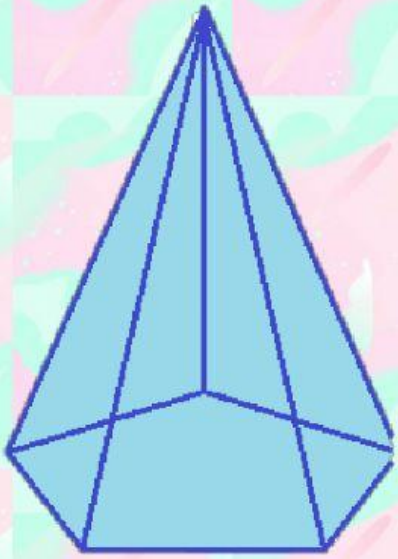

Prisma Triangular

Pirámide Pentagonal

Pirámide Decagonal

Calcular Área Total y Volumen de la siguiente pirámide

Área de Base

$$Áb = \frac{P * ap}{2}$$

$$Áb =$$

$$Áb =$$

$$Áb = \qquad cm^2$$

Área Lateral

$$Ál = \frac{P * ap}{2}$$

$$Ál =$$

$$Ál =$$

$$Ál = \qquad cm^2$$

Área Total

$$\text{Át} = Al + Ab$$

$$\text{Át} =$$

$$\text{Át} = \qquad cm^2$$

Volumen

$$\text{V} = \frac{\text{Ab} * \text{h}}{3}$$

$$\text{V} =$$

$$\text{V} =$$

$$\text{V} = \qquad cm^3$$

Unir con líneas según corresponda

Figuras

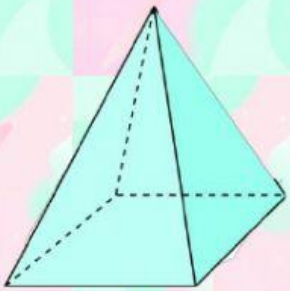





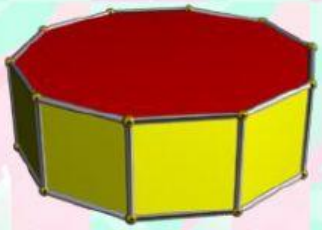

Nombre de la figura

Prisma decagonal

Pirámide cuadrangular

Prisma Triangular

Pirámide Hexagonal

Cubo