Electron Pattern

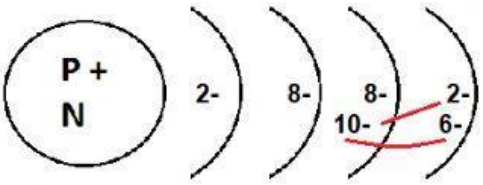

5. Repeat the process for the last three elements.

A. Neon **Protons _____ Neutrons _____ Electrons _____**



Bohr Models

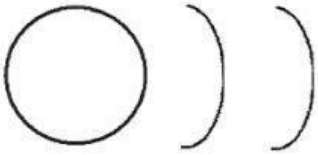

Dot Diagram

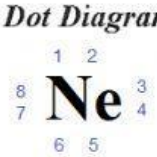

Family ____ *Period* ___

View a periodic Table

Check the dot diagram

B. Argon **Protons _____ Neutrons _____ Electrons _____**



Bohr Model

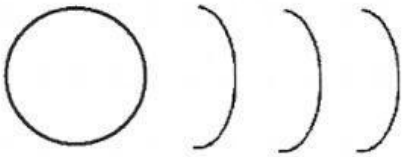

Dot Diagram



Family ____ *Period* ___

Check the dot diagram

C. Krypton **Protons _____ Neutrons _____ Electrons _____**

Bohr Model

Dot Diagram

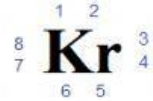

Family ____ *Period* ___

Check the dot diagram

1. What do all these models have in common?_____
2. What is there common location on the periodic table?_____
3. **Look at the periodic table.**

   What period is Cesium in?_____

   How many energy levels would the model of Cesium have? _____

   What family is Cesium in? _____.

   How many valence electron does Cesium have?_____.

LIVEWORKSHEETS