Nama Peserta Didik :

LKT3ST2PB5

Nomor Absen :

1. Selesaikanlah soal berikut.

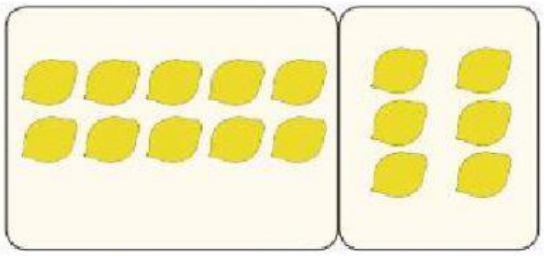

1 puluhan 6 satuan

... enam belas

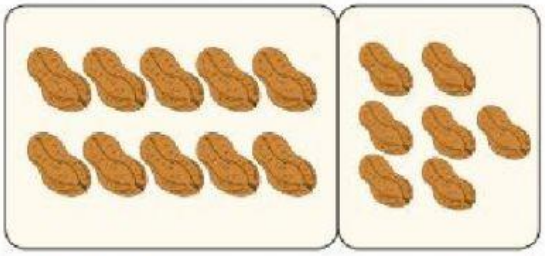

... puluhan ... satuan

17 tujuh belas

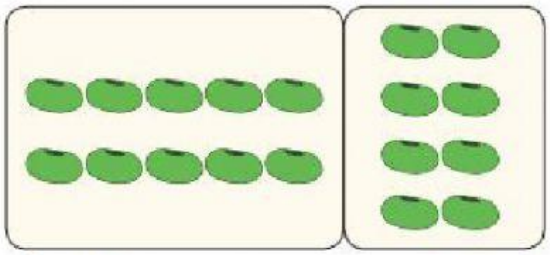

1 puluhan 8 satuan

... delapan belas

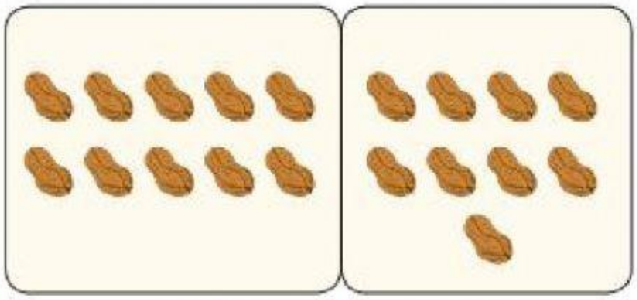

... puluhan ... satuan

... ...

2. Kerjakanlah soal berikut seperti contoh pada buku.



[ ] = [ ] puluhan [ ] satuan

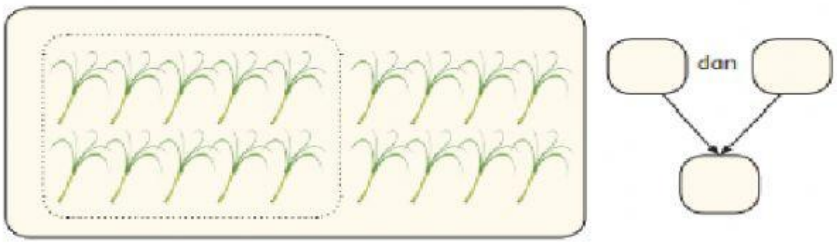

[ ] = [ ] puluhan [ ] satuan

3. Berikut ini adalah gambar ke
dilakukan orang di siang hari.

bekerja di kantor

berkebun

bertani

memasak