Name _____ worksheet1 grade _____

Question.1 Look at the picture , write the decimal number for it

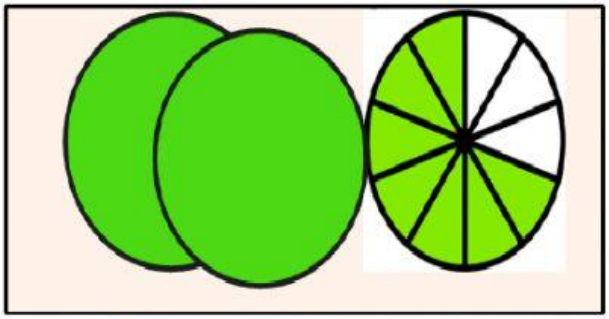





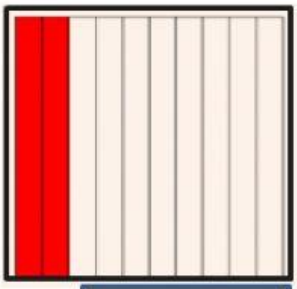





Question 2 write each number in standard form :

a)Two whole and one tenth

b) three tenths

c) four thousandths

d) twenty-nine thousandths

e)thirty-nine thousandths

f) six hundred-two thousandths

g) ninety-six hundredths

I) thirty-five hundredths

Question.3 write the value of the underlined digit

a) 5.00<u>4</u>

b) 1.0<u>2</u>

c) 0.<u>2</u>6

d) 0.00<u>9</u>

e) 0.<u>3</u>7

f) 1.20<u>6</u>

g) 6.0<u>9</u>1

h) 0.<u>1</u>99

I) 0.1<u>3</u>

k) <u>2</u>.005

Question.4 write each fraction as a decimal

$\frac{5}{100}$ $\frac{5}{10}$ $\frac{5}{1000}$ $\frac{7}{100}$

$\frac{7}{1000}$ $\frac{17}{1000}$ $\frac{28}{1000}$ $\frac{289}{1000}$