Marca los números 18 que encuentres

12	18	19	18	11	18	15
18	18	13	12	15	13	14
15	11	14	18	19	18	11
18	13	18	16	18	12	18
14	15	12	18	11	13	6
17	18	13	19	14	18	15
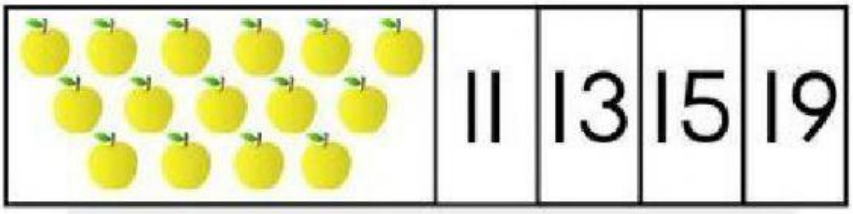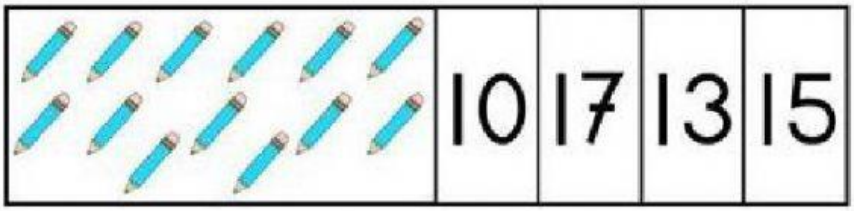
Cuenta los elementos y marca el número que le corresponde.