Guía de matemática "Geometría"

I Calcule perímetro y área

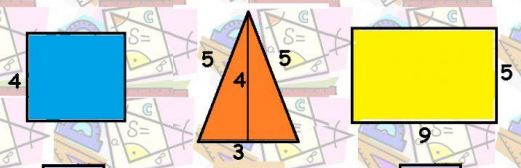

P | P= | P=

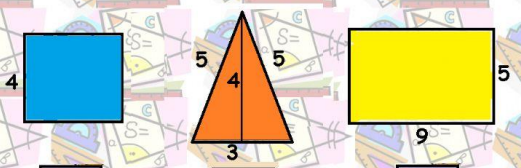

A= | A= | A=

II Marca la alternativa correcta a las preguntas

a) ¿Cuántos metros recorrerá la niña para dar la vuelta la parque?

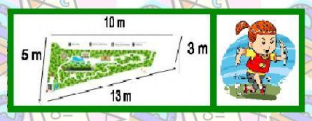

13 m | 25 m | 31 m

b) ¿Cuántos metros de piso limpió el señor?

99 m | 91 m | 111 m

III Calcule área y volumen

A= cm^2 | V= cm^3

A= cm^2 | V= cm^3

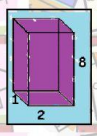

A= cm^2 | V= cm^3

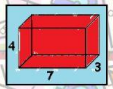

A= cm^2 | V= cm^3