ÁREA DEL TRIÁNGULO

Hallar el área de los siguientes triángulos.

a)

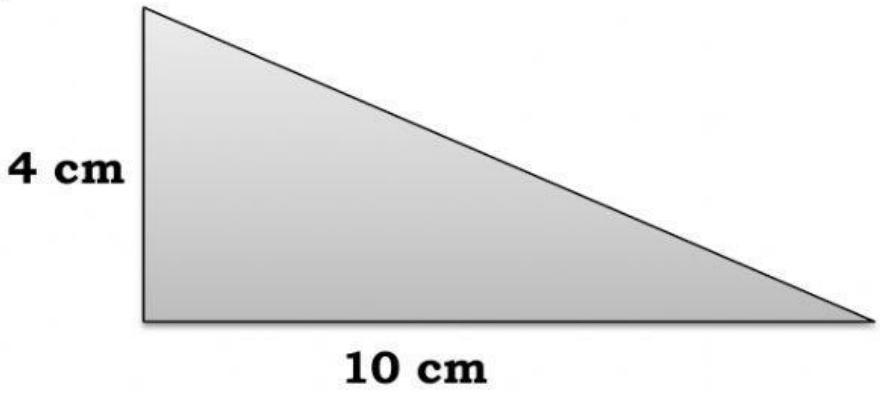

$$A = \frac{\square \times \square}{\square} = \frac{\square}{\square} = \square \text{ cm}^2$$

b)

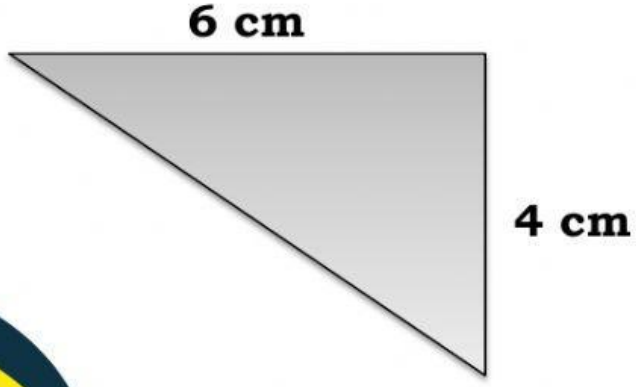

$$A = \frac{\square \times \square}{\square} = \frac{\square}{\square} = \square \text{ cm}^2$$

c)

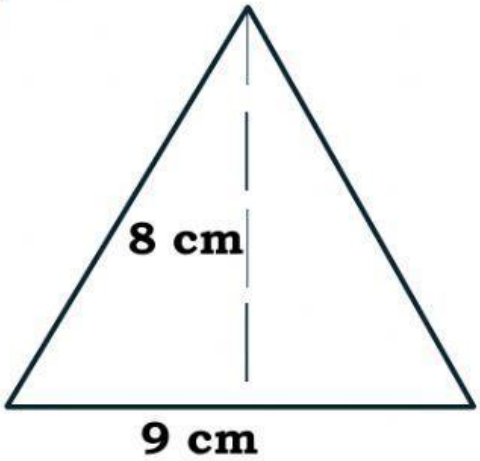

$$A = \frac{\square \times \square}{\square} = \frac{\square}{\square} = \square \text{ cm}^2$$

d)

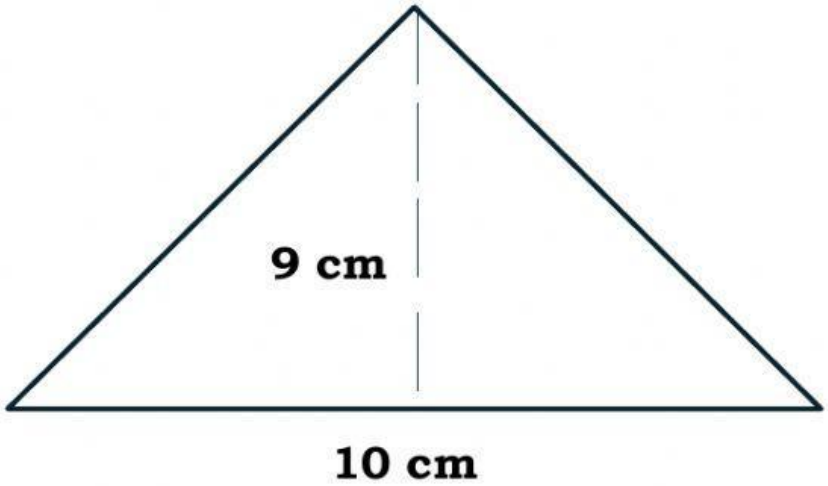

$$A = \frac{\square \times \square}{\square} = \frac{\square}{\square} = \square \text{ cm}^2$$

e)

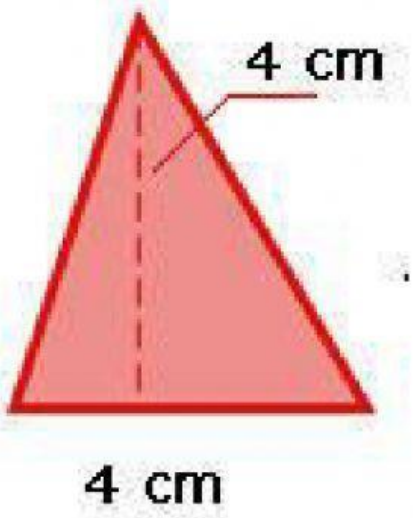

$$A = \frac{\square \times \square}{\square} = \frac{\square}{\square} = \square \text{ cm}^2$$

f)

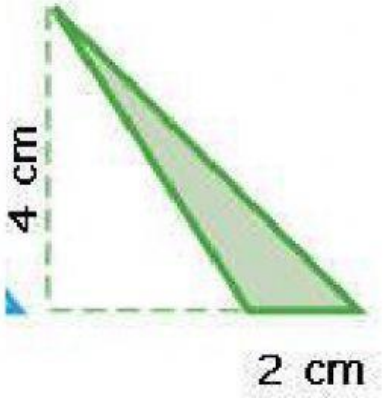

$$A = \frac{\square \times \square}{\square} = \frac{\square}{\square} = \square \text{ cm}^2$$

g)

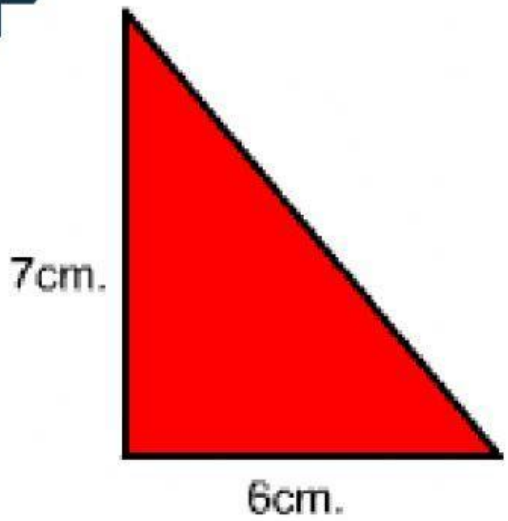

$$A = \frac{\square \times \square}{\square} = \frac{\square}{\square} = \square \text{ cm}^2$$

h)

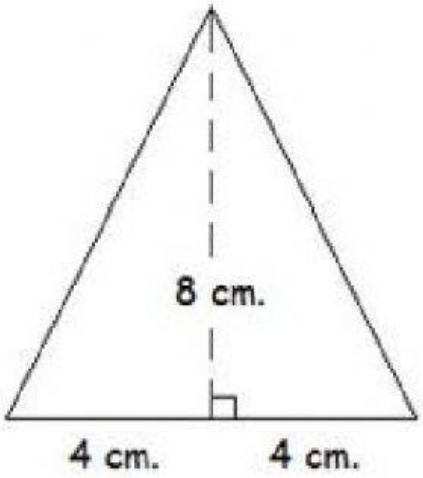

$$A = \frac{\square \times \square}{\square} = \frac{\square}{\square} = \square \text{ cm}^2$$

i)

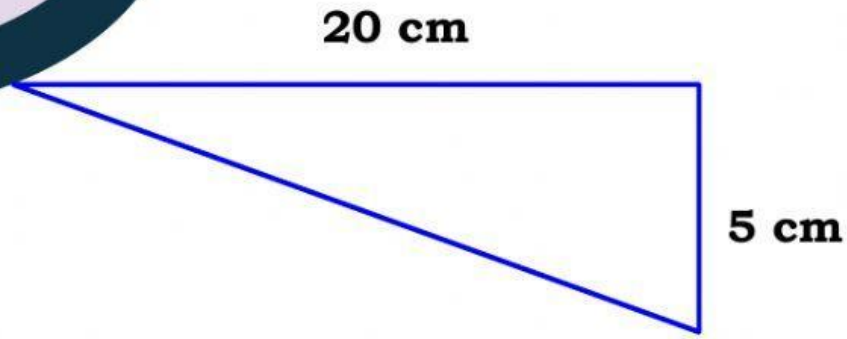

$$A = \frac{\square \times \square}{\square} = \frac{\square}{\square} = \square \text{ cm}^2$$

j)

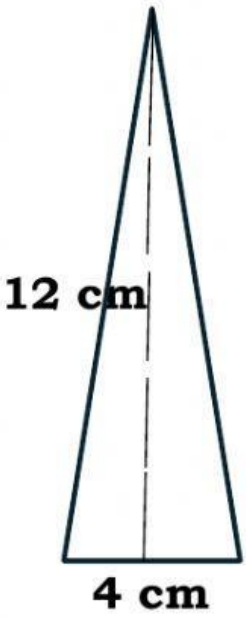

$$A = \frac{\square \times \square}{\square} = \frac{\square}{\square} = \square \text{ cm}^2$$