UNIDAD EDUCATIVA TÉCNICO SALESIANO

2020-2021

NOMBRE	
CURSO	

1. Una lo correcto. ¿Cuál corresponde al área sombreada?

(AUB)'

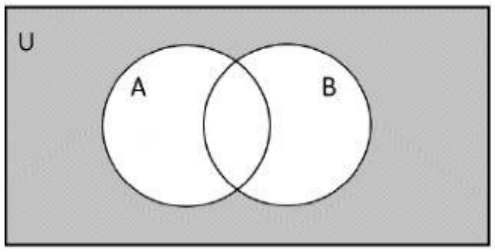

(A')'

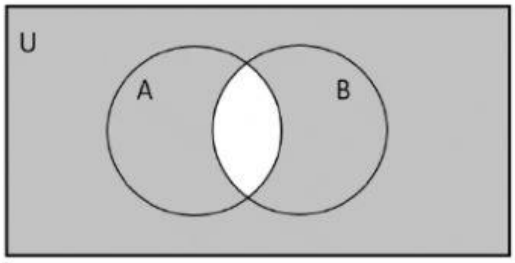

(A∩B)'

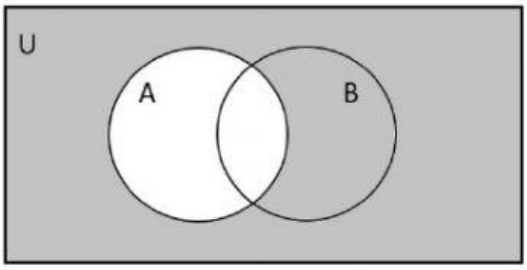

A'

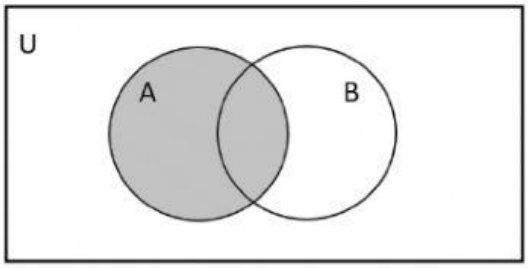

2. Del siguiente gráfico halle lo que se solicitado. Coloque los números de menor a mayor separado por una coma.

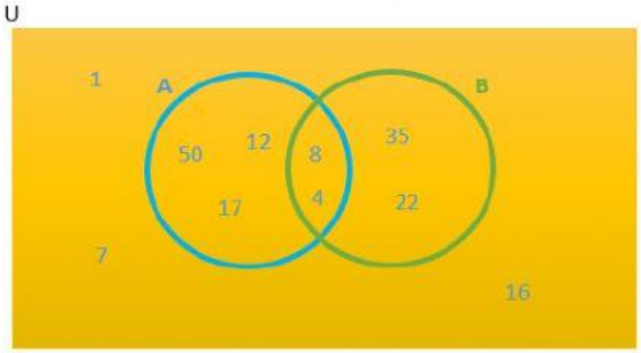

(A')' ={ }

(AUB)' ={ }

B' ={ }

A' ={ }

3. Grafique en una hoja los conjuntos y responda.

U={2,5,9,12,17,23,25,37}

A={5,9,12,17}

B={2,5,17,23,25}

(A')' ={ }

(AUB)' ={ }

(A∩B)' ={ }

B' ={ }