CLIMAS DO MUNDO E VEGETAÇÃO

1. Coloque o nome do clima correspondente a cada climograma.

EQUATORIAL | TROPICAL | MONÇÕES | TEMPERADO | MEDITERRÂNEO

DESÉRTICO | FRIO | POLAR | SEMIÁRIDO

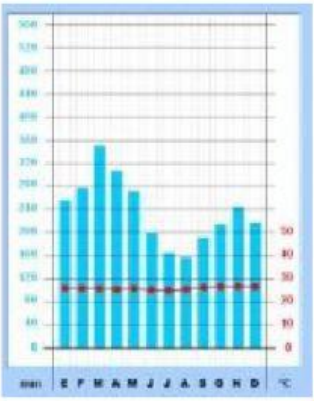

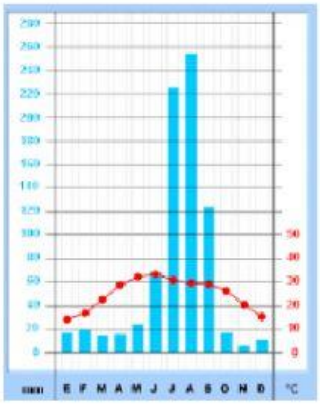

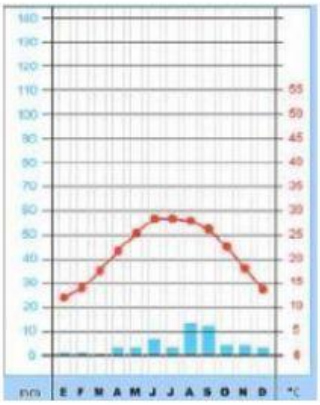

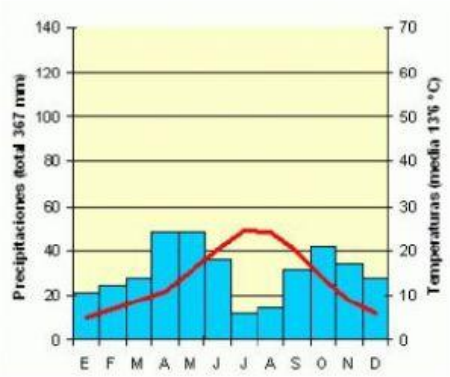

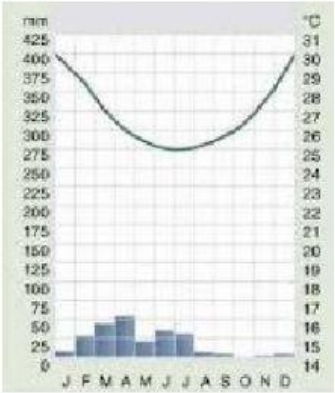

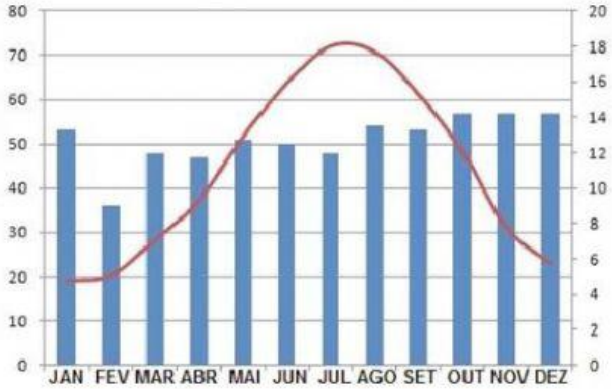

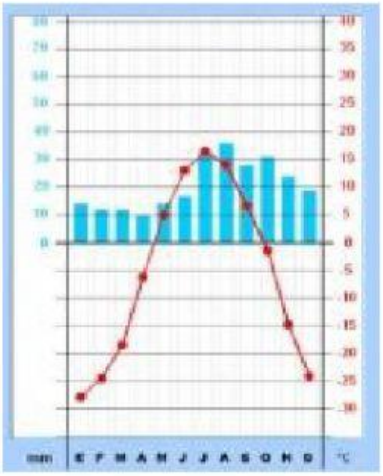

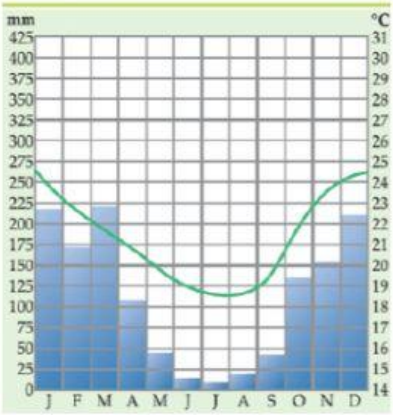

2. Ligue o número correspondente ao local do mapa com o clima da região representada.

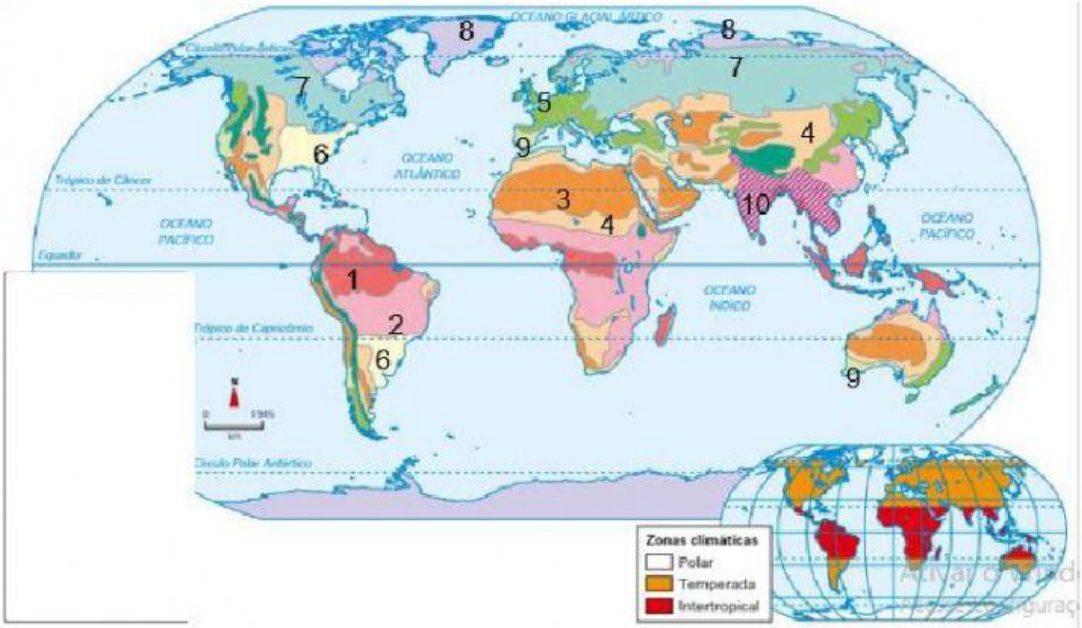

Área 1.	**Clima equatorial**
Área 2.	**Clima de monções**
Área 3.	**Clima temperado**
Área 4.	**Clima semiárido**
Área 5.	**Clima tropical**
Área 6.	**Clima mediterrâneo**
Área 7.	**Clima subtropical**
Área 8.	**Clima frio**
Área 9.	**Clima polar**
Área 10.	**Clima desértico**

3. Associe o clima à vegetação correspondente

1. Floreta temperada	**Clima equatorial**
2. Floresta boreal	**Clima mediterrâneo**
3. Tundra	**Clima polar**
4. Estepes	**Clima semiárido**
5. Savana	**Clima tropical típico**
6. Vegetação mediterrânea	**Clima frio**
7. Floresta equatorial	**Clima temperado**
8. Floresta tropical	**Clima tropical úmido**