Mathematics

Decimals

Monday

What is the amount of water in each container in liters?
Express each answer as a decimal.

a)

_____ L

b)

_____ L

What is the mass of each item in kilograms?
Express each answer as a decimal.

a)

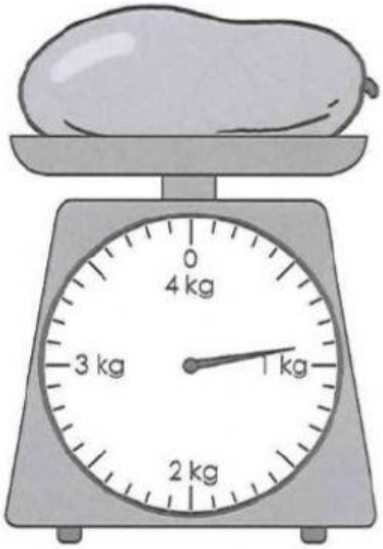

_____ kg

b)



_____ kg

Write a decimal for each of the following.

a)



2 tenths = _____

b)

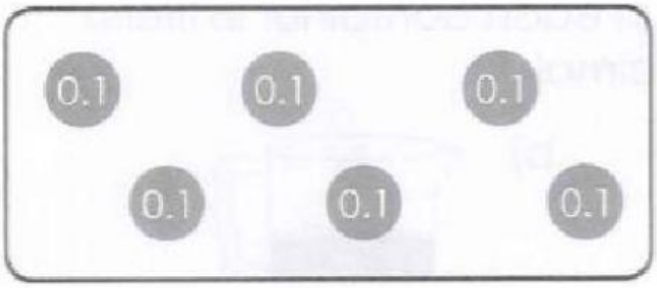

6 tenths = _____

c)



9 tenths = _____

Express each fraction as a decimal.

a)

2 tenths

$\frac{2}{10}$ = _____

b)



5 tenths

$\frac{5}{10}$ = _____

c)

8 tenths

$\frac{8}{10}$ = _____

d)

9 tenths

$\frac{9}{10}$ = _____

Fill in the missing numbers.

a)

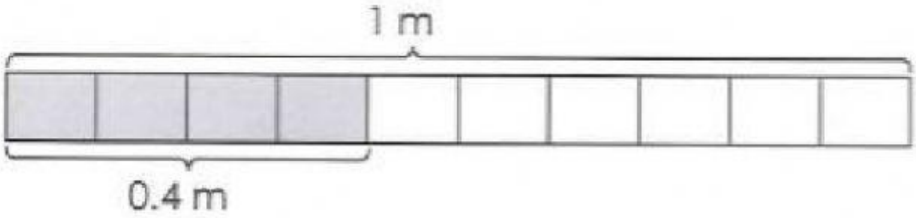

$0.4\text{ m} = \frac{4}{\square}$ of 1 m

b)

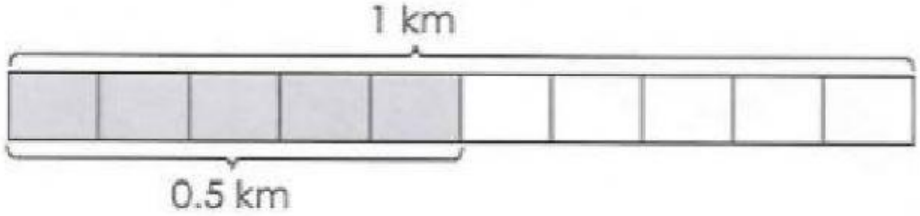

$0.5\text{ km} = \frac{5}{\square}$ of 1 km

c)

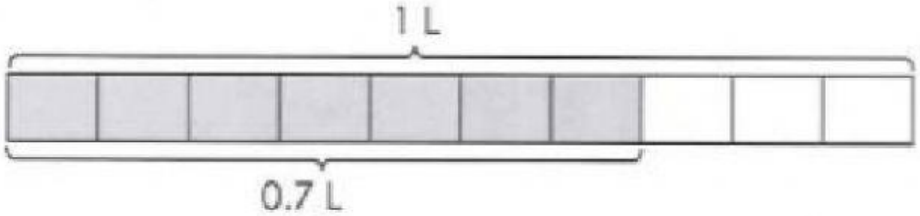

$0.7\text{ L} = \frac{\square}{10}$ of 1 L

Fill in the missing decimals.

Example

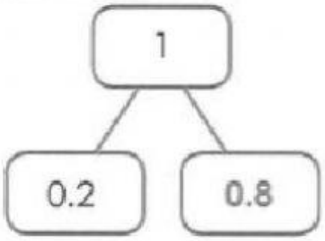

a)

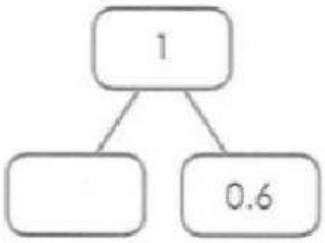

b)

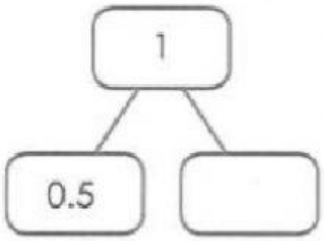
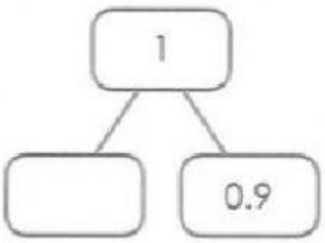
c)