Write the numbers in the third row of 301 to 400 hundred chart. (left to right)

……., ……., ……., ……., ……., ……., ……., ……., ……., …….

Write the numbers in the second column of 601 to 700 hundred chart. (up to down)

……., ……., ……., ……., ……., ……., ……., ……., ……., …….

Write the numbers in the fifth row of 801 to 900 hundred chart. (left to right)

……., ……., ……., ……., ……., ……., ……., ……., ……., …….

Write the numbers in the fourth row of 901 to 1000 hundred chart. (left to right)

……., ……., ……., ……., ……., ……., ……., ……., ……., …….

Write the numbers in the tenth column of 901 to 1000 hundred chart. (up to down)

……., ……., ……., ……., ……., ……., ……., ……., ……., …….

Add by using the number bonds.

(1) 71 + 4 = ...

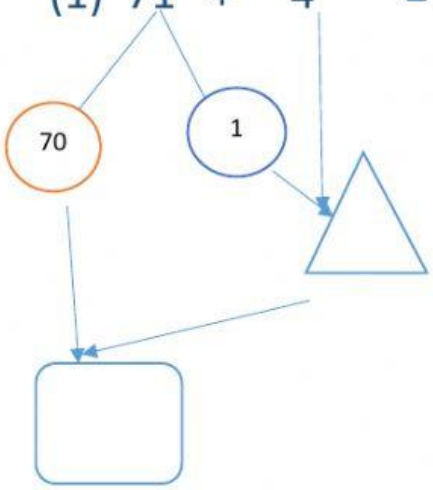

(2) 921 + 7 = ...

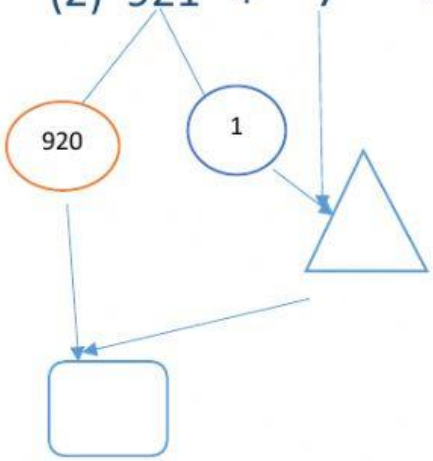

(3) 759 + 30 = ...

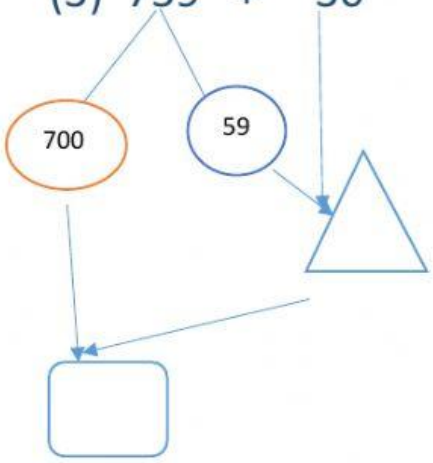

(4) 314 + 60 = ...

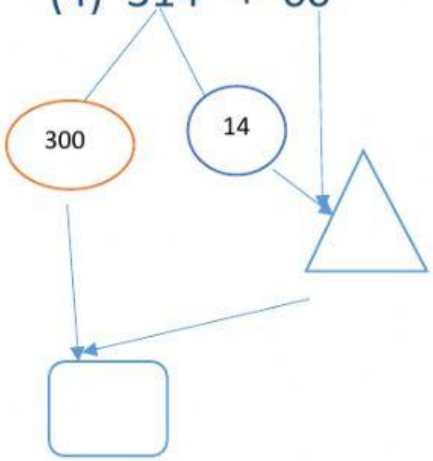

(5) 762 + 200 = ...

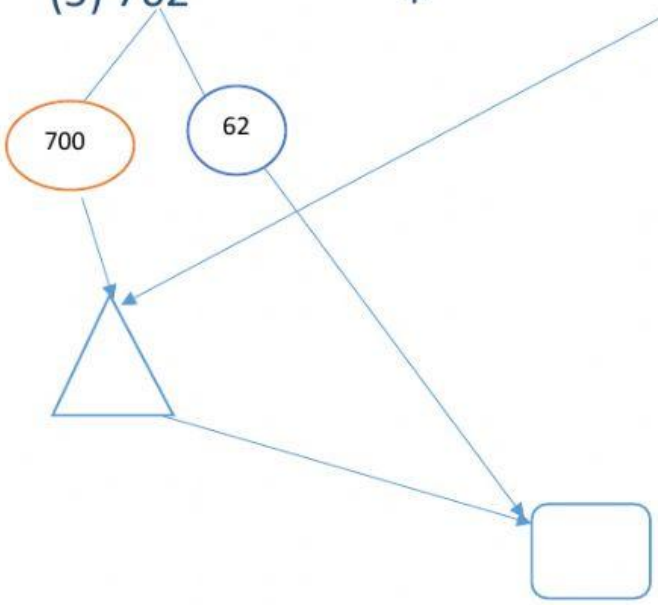

Add by counting on in ones / tens/ hundreds.

(1) 725 + 4

725				

So 725 + 4 =.....

(2) 755 + 40

755				

So 755+40=.....

(3) 623 + 4

623				

So 623+4=.....

(4) 531 + 40

531				

So 531+40=.....

(5) 416 + 70

416							

So 416+70=.....

(6) 239 + 700

239							

So 239+700=.....