UPSALA COLLEGE	**Materia:** Matemática
	Docente: Lucila Fernández Salcedo
	FRACCIONES

1. Escribir la fracción impropia que corresponde en cada caso:

Gráfico	Fracción
	$\frac{\square}{\square}$
	$\frac{\square}{\square}$
	$\frac{\square}{\square}$
	$\frac{\square}{\square}$
	$\frac{\square}{\square}$
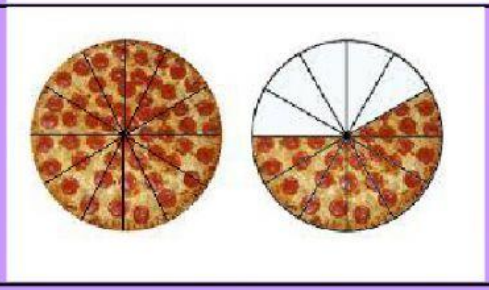	$\frac{\square}{\square}$