DINAS PENDIDIKAN KOTA TASIKMALAYA
SD LABORATORIUM UPI KAMPUS TASIKMALAYA
Akreditasi : "A" (Unggul) No. 02.00/203/SK/BAN-SM/XII/2018
Jalan Dadaha No. 18 ☎ (0265)7527155 ✉ 46115 Kota Tasikmalaya

Latihan Matematika Tema 2 Subtema 3 KD 3.6 "Bangun Datar"

A. Berilah tanda ( ) pada gambar-gambar yang termasuk **balok** !

B. Berilah tanda ( ) pada gambar-gambar yang termasuk **kubus** !

C. Pasangkan benda sesuai bentuknya!

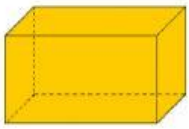

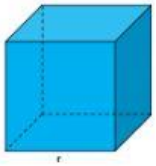

D. Perhatikan gambar di bawah ini!

Silakan hitung ada berapa jumlah masing-masing bangun datar!

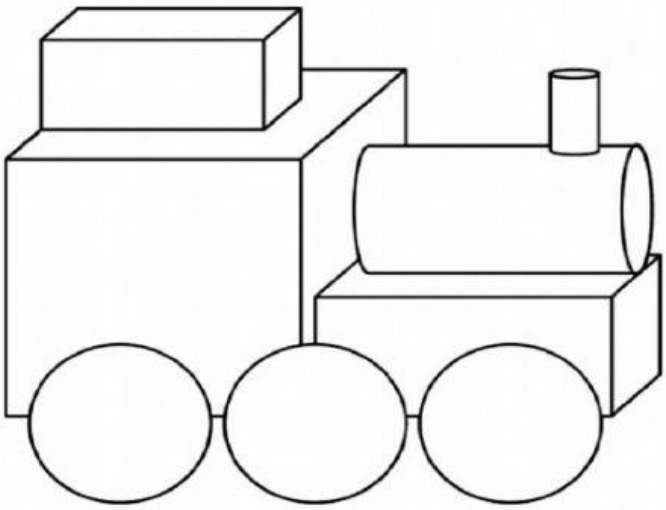



Jumlahnya ada

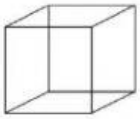

Jumlahnya ada

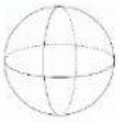

Jumlahnya ada

Jumlahnya ada