Tentukan bilangan yang tepat untuk soal berikut!

1.

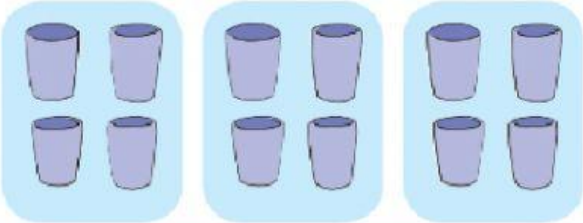

..... × ..... = ...

2.



..... × ..... = ...

3.



..... × ..... = ...

4.

..... × ..... = ...

5. Beni membeli kelereng.
Kelereng tersebut dimasukkan ke dalam 4 kantong.
Setiap kantong berisi 7 kelereng.

a. Tulislah kalimat matematikanya!

.....

.....

b. Tentukan hasilnya!

.....

.....