Decenas y unidades

Nombre:_____

Cuenta las decenas y unidades. Colorea el círculo correcto.

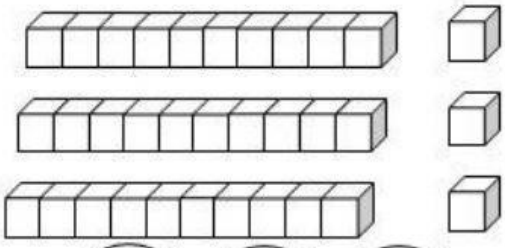

35 32 33

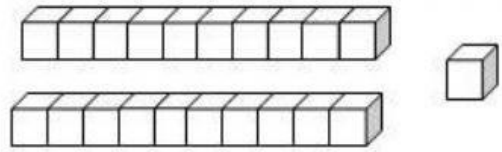

24 21 20

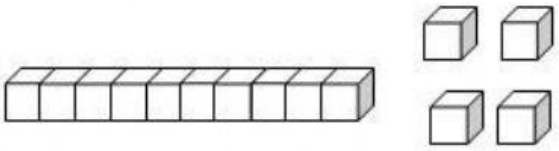

14 17 15

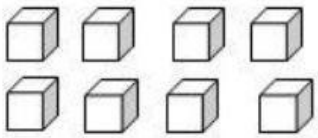

10 8 7

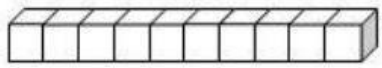

10 20 30

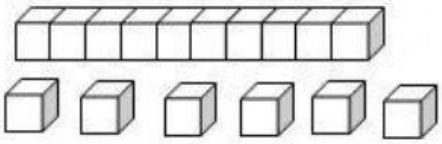

18 17 16

Material de Mundo ABC