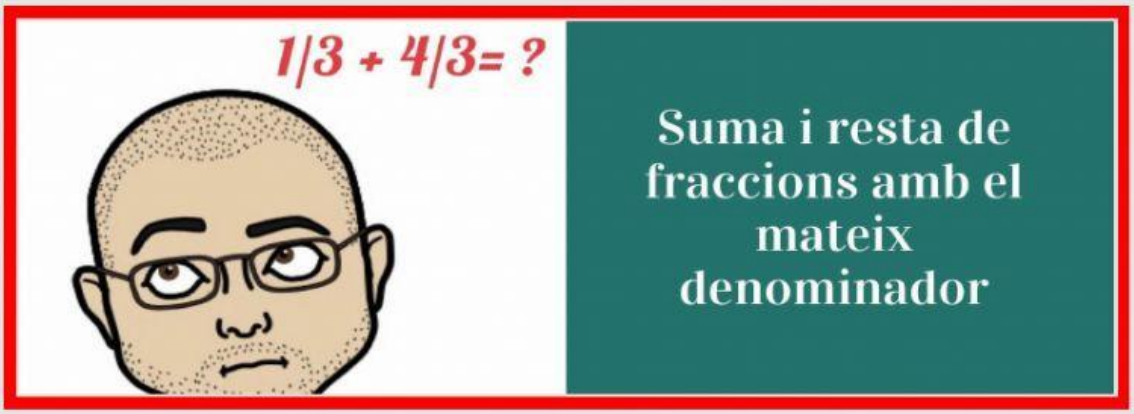

1. **<u>SUMA</u> aquestes parelles de fraccions. Primer clica a la figura final tants quadrats com correspongui a la suma final; però clica'ls per ordre! Per exemple, si en total sumen 3 quadrats, clica els quadrats 1, 2 i 3. Finalment emplena la fracció final:**

a)

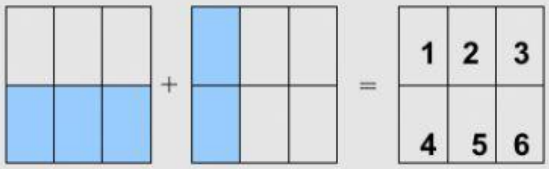

___ + ___ = ___

b)

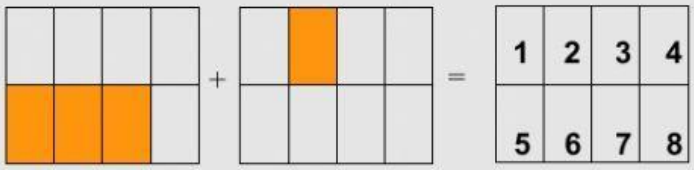

___ + ___ = ___

c)



___ + ___ = ___

2. Resol aquestes sumes:

a) $\frac{6}{7} + \frac{5}{7} = ___$ b) $\frac{9}{3} + \frac{4}{3} = ___$ c) $\frac{8}{4} + \frac{8}{4} = ___$

d) $\frac{3}{5} + \frac{7}{5} = ___$ e) $\frac{6}{8} + \frac{9}{8} = ___$ f) $\frac{8}{2} + \frac{8}{2} + \frac{6}{2} = ___$

3. <u>RESTA</u> aquestes parelles de fraccions. Clica a la figura tants quadrats blaus com vulguis llevar segons indica la segona fracció, però clica'ls per ordre! Per exemple, si vols llevar 2 quadrats, clica els quadrats 1 i 2. Després complea els denominadors i finalment emplena la fracció final:

a)

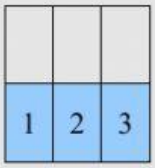

$\frac{3}{6} - \frac{1}{6} = ___$

b)

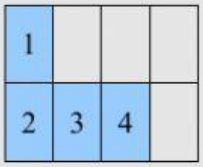

$\frac{4}{___} - \frac{3}{___} = ___$

c)

$\frac{7}{___} - \frac{4}{___} = ___$

4. Resol aquestes restes:

a) $\frac{6}{7} - \frac{5}{7} = ___$ b) $\frac{9}{3} - \frac{4}{3} = ___$ c) $\frac{8}{4} - \frac{3}{4} = ___$

d) $\frac{7}{5} - \frac{6}{5} = ___$ e) $\frac{3}{8} - \frac{1}{8} = ___$ f) $\frac{8}{2} - \frac{6}{2} = ___$

5. Pensa quins nombres falten:

a) $___ - \frac{5}{8} = \frac{2}{8}$ b) $___ + \frac{4}{3} = \frac{9}{3}$ c) $___ - \frac{3}{6} = \frac{5}{6}$ d) $___ + \frac{6}{5} = \frac{13}{5}$