**Bilangan Desimal**
**SDK 6 BPK PENABUR**

| | | | |
|---|---|---|---|
| Kelas/Semester : IV/1<br>Mata Pelajaran : Matematika<br>Materi : Mengenal Bilangan Desimal<br>Kompetensi : 3.2 Menjelaskan berbagai bentuk pecahan (biasa, campuran, desimal, dan persen) dan hubungan di antaranya. | Nama : | Nilai | TTOT |
| | Kelas/No.: | | |
| | Tanggal : | | |

**1. Tuliskan bilangan desimalnya menurut bagian yang diarsir!**

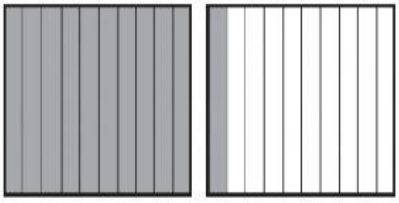

a



b

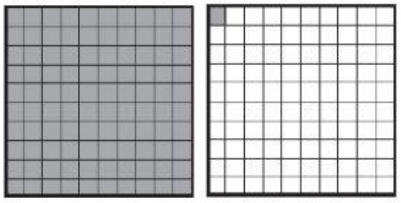

c

**Tuliskan bagian yang diarsir dalam bentuk pecahan dan bilangan desimal!**

| | | | | | |
|---|---|---|---|---|---|
| 2 |  | a) _____<br>b) _____ | 3 |  | a) _____<br>b) _____ |
| 4 |  | a) _____<br>b) _____ | 5 |  | a) _____<br>b) _____ |

**Tulislah bilangan desimal!**

6. $\frac{8}{10}$ = ....

7. $\frac{23}{100}$ = ....

8. $\frac{258}{100}$ = ....

9. $3\frac{4}{10}$ = ....

**Isilah titik-titik berikut ini!**

10. 0,45 = 0 **satuan** _____ **persepuluhan** 5 **perseratusan**
11. 8 **satuan** 4 **perspuluhan** 9 **perseratusan** = …..
12. Pada bilangan 0,67 angka 6 menempati nilai tempat ….
13. Nilai tempat seperseratus pada bilangan 0,146 adalah ….
14. 0,12 nama bilangannya adalah ….