ACTIVIDAD EVALUATIVA

Nombre: Fecha:

Realiza las siguientes actividades

1. ¿Cuál de las dos representaciones expresa una igualdad? Marca (X)

a.

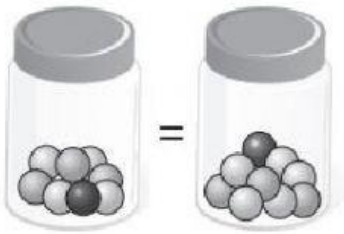

b.

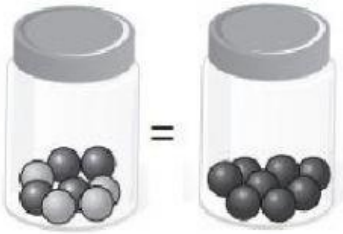

2. Calcula la masa de cada conserva.

a.

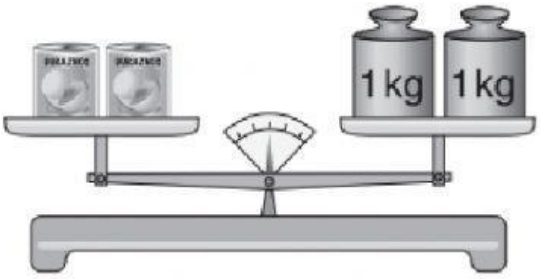

Las conservas de durazno

pesan_____Kg.

b.

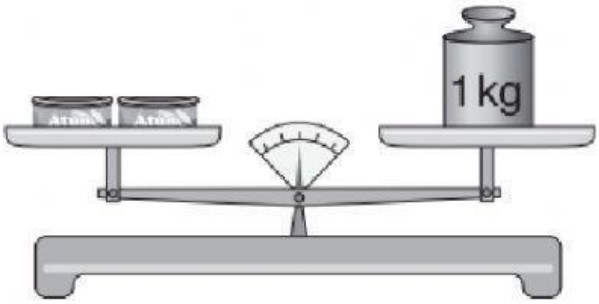

Las conservas de atún

pesan_____Kg.