Friday August 14th, 2020

Practice
10-5

Polygons

Choose the **name for each polygon.**

1. 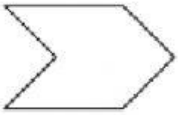

2. 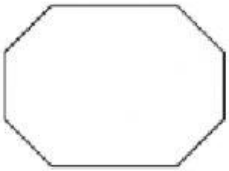

3. 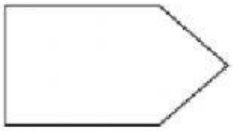

4. 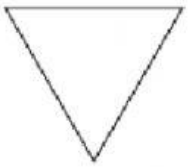

_____ _____ _____ _____

Is each figure a polygon? Choose yes or no.

1. 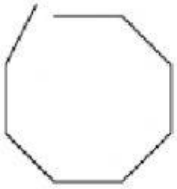

Yes

No

2. 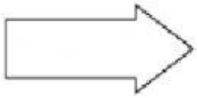

Yes

No

3. 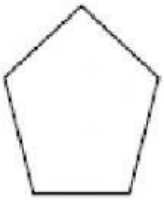

Yes

No

4. 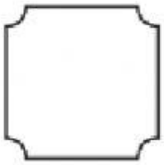

Yes

No

Choose the **name of the polygon** that each traffic sign looks like.

1.

_____

2.

_____

3.

_____

4.

_____

5.

_____

6.

_____

Complete the following **multiplication tables.**

3 x 3 = _____ 6 x 9 = _____ 8 x 8 = _____

9 x 7 = _____ 10 x 8 = _____ 7 x 3 = _____