Elige la opción correcta. ¿Qué fracción está pintada?

$\frac{3}{1}$ $\frac{6}{5}$ $\frac{6}{7}$ $\frac{5}{6}$

$\frac{1}{3}$ $\frac{3}{1}$ $\frac{2}{3}$ $\frac{4}{1}$

$\frac{4}{6}$ $\frac{5}{4}$ $\frac{3}{5}$ $\frac{5}{3}$

$\frac{4}{10}$ $\frac{5}{12}$ $\frac{3}{11}$ $\frac{3}{10}$

$\frac{4}{8}$ $\frac{7}{4}$ $\frac{4}{6}$ $\frac{4}{7}$

$\frac{4}{10}$ $\frac{5}{12}$ $\frac{4}{14}$ $\frac{6}{12}$

1. Marcá las fracciones impropias

$\frac{1}{4}$ $\frac{8}{3}$ $\frac{7}{9}$ $\frac{10}{4}$ $\frac{12}{5}$ $\frac{1}{2}$ $\frac{2}{5}$ $\frac{4}{3}$

$\frac{11}{6}$ $\frac{8}{6}$ $\frac{10}{3}$ $\frac{1}{3}$ $\frac{15}{2}$ $\frac{2}{7}$ $\frac{8}{5}$ $\frac{4}{9}$

2. ¿Qué fracción representa cada dibujo?

a)





b)



c)