Adding Ten

1.

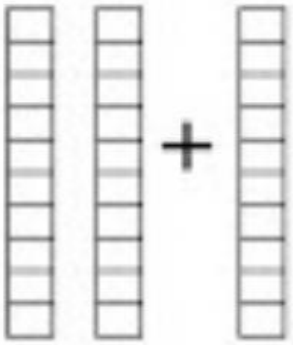

____ + ____ = ____

2.

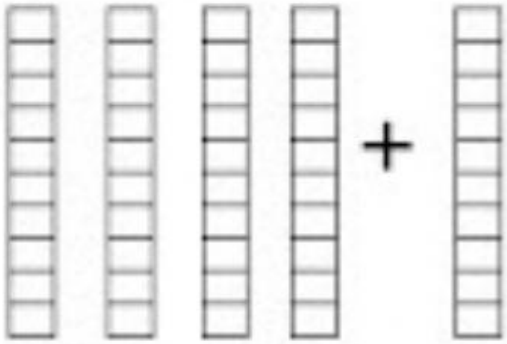

____ + ____ = ____

3.

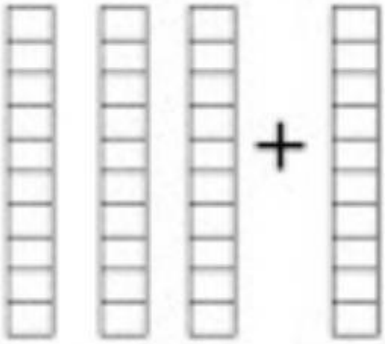

____ + ____ = ____

4.

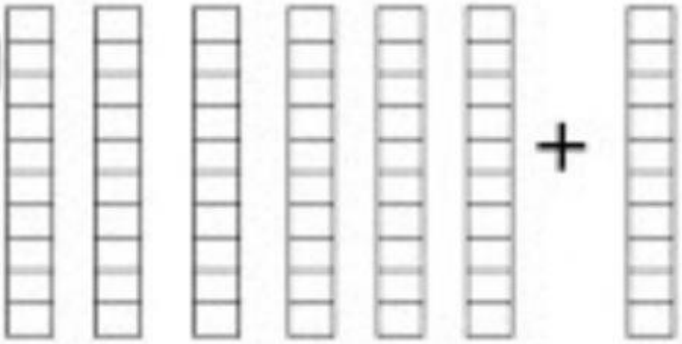

____ + ____ = ____

5.

50 + 10= ☐ 80 + 10= ☐

10 + 10= ☐ 70 + 10= ☐