MATEMÁTICA
IV SECUNDARIA
Ficha 4: Triángulos 2

TRIANGULOS NOTABLES

TEOREMA DE PITÁGORAS

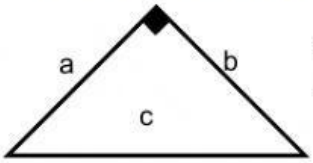

$$c^2 = a^2 + b^2$$

Se denomina triángulo rectángulo notable a aquel, que conociendo las medidas de sus ángulos se conoce también la relación que guardan entre sí las longitudes de sus lados. Los principales son los siguientes:

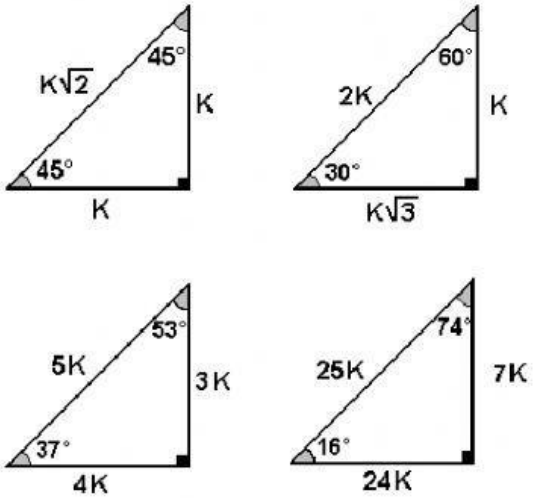

Ejercicios 1

1.- Halla "x":

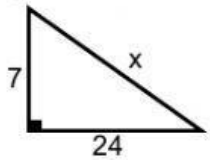

2. Halla "x"

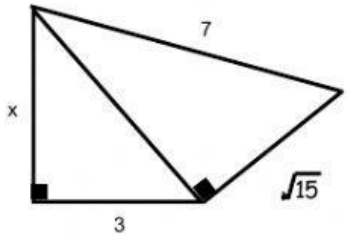

3. Halla "x"

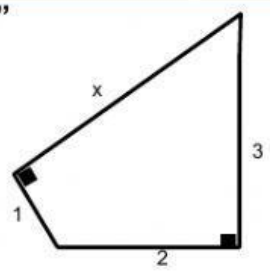

4. Halla AH. Si: AB = 8

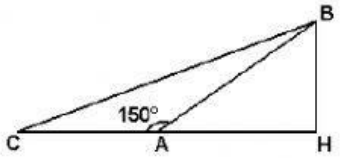

5 - Halla "m + n"

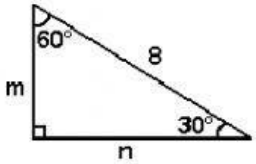

6...- Halla "x"

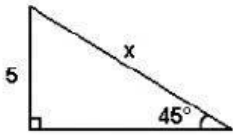

7 - Halla "x"

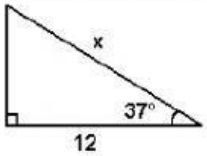

8.- Halla "k".

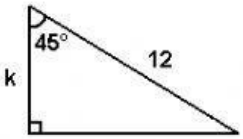

9.- Halla "x".

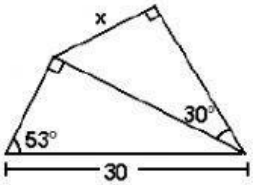

10.- Halla "x".

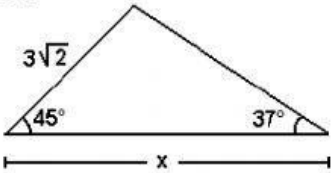

11.- Halla "x".

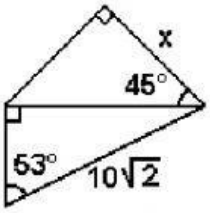

12.- Halla "m"

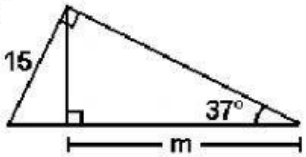

13.- Halla "x"

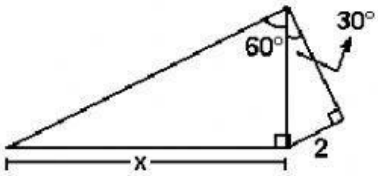

14. Halla "x" en:

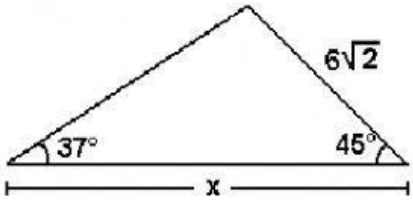

Ejercicios 2

01.- Del gráfico, halla "x"

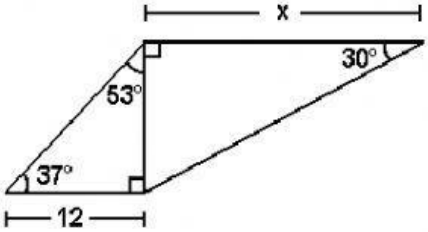

02.- Calcular AC, AM=5 ABCD es un cuadrado.

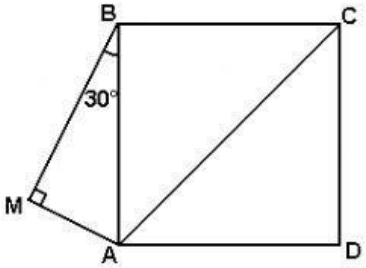

03.- Halla "x"

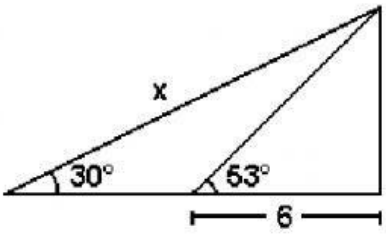

04.- Halla "x"

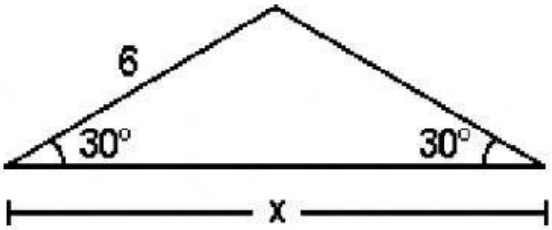

05.- Hallar "x"

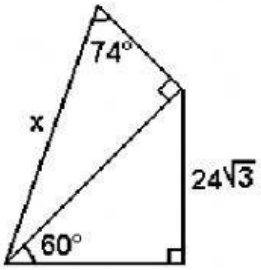

06.- Halla "x"

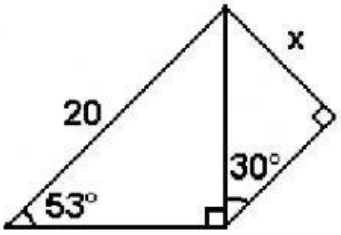

07.- Halla "x"

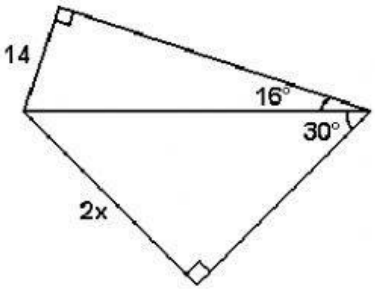

08.- Halla "x"

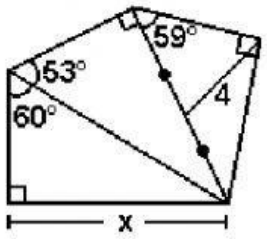

09.- Hallar "x + y".

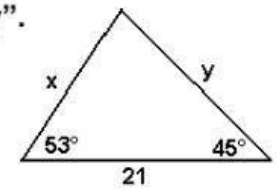

10.- Si el lado del cuadrado PQRS es 12cm. Halla "AC".

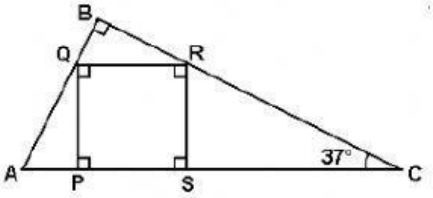

11. Halla "x"

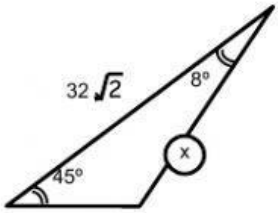

12. Halla "x"

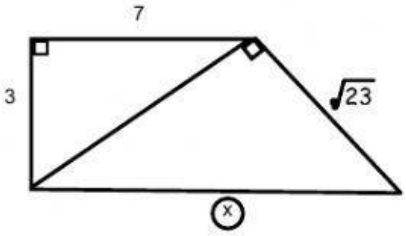

13. Halla x:

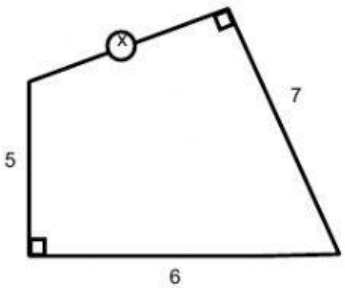

14. Halla (a – b)

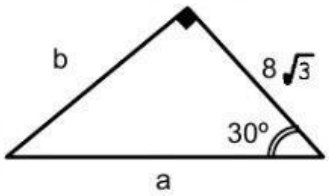

15. Halla "x"

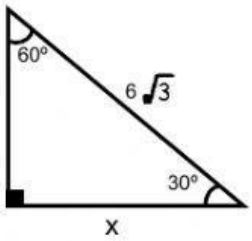

16. Halla "y"

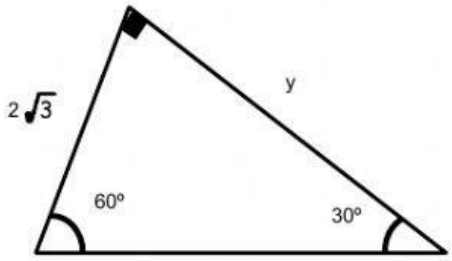

17. Calcula "x":

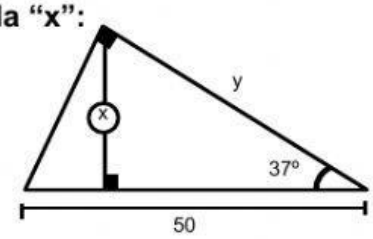

18. Halla "x":

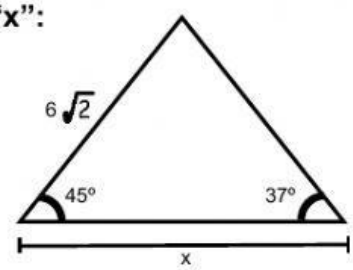

19. Calcula "x":

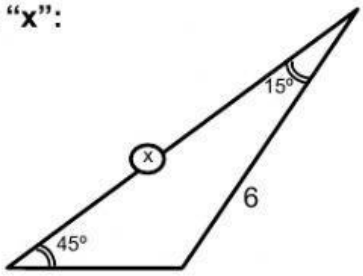
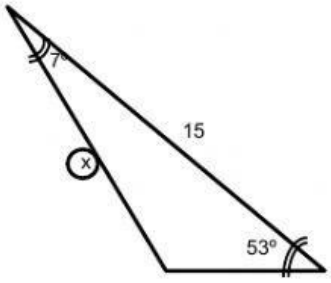
20. Calcular "x":