Polígons: àrea

1.- Calcula l'àrea dels següents polígons. Fes els càlculs en un paper.

a)

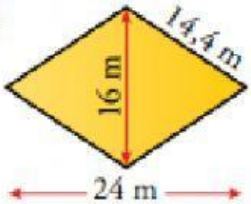

m^2

b)

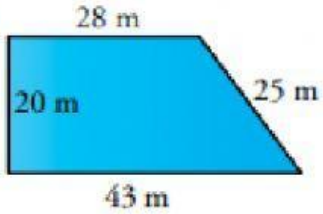

m^2

c)

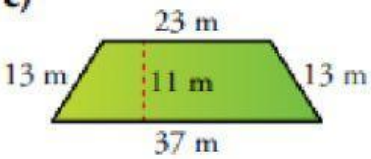

m^2

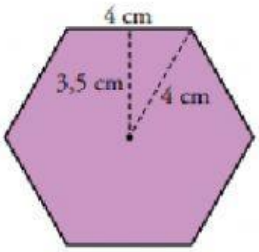

cm^2

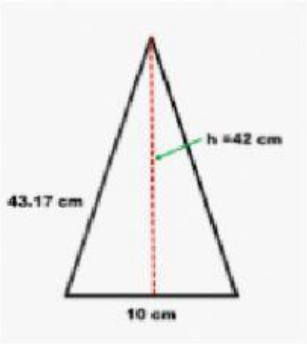

cm^2

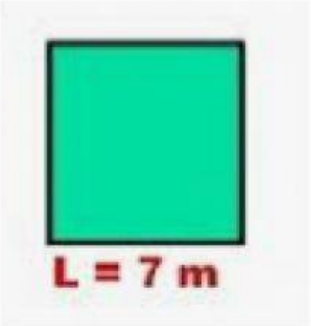

m^2

m^2

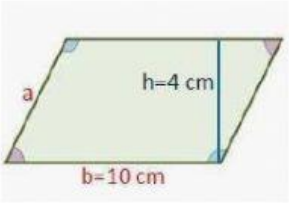

cm^2

d)

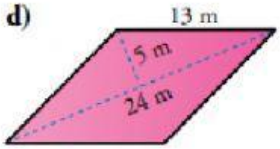

m^2