ADICIONES

1.- Ubica los sumandos en el tablero posicional, luego halla la suma.

9 + 6

D	U

7 + 4

D	U

11 + 7

D	U

2.- Escribe los sumandos en cada caso y resuelve.

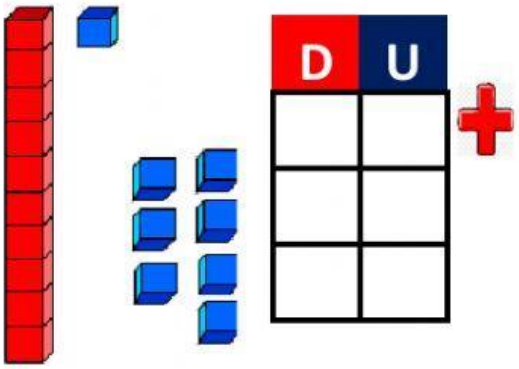

D	U

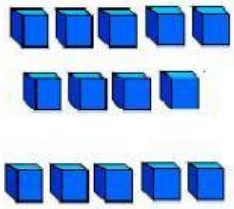

D	U

3.- Observa la recta numérica y completa con uno de los sumandos y la suma.

7 + ☐ =

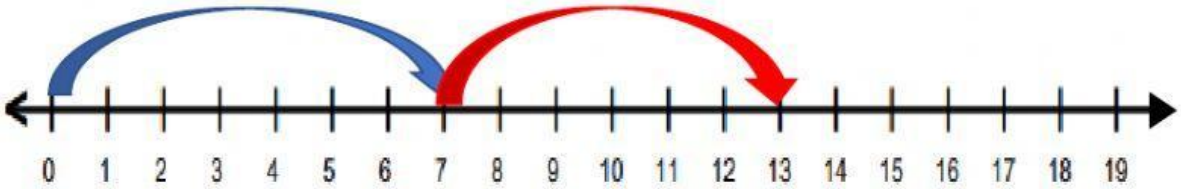

$\square + 4 =$

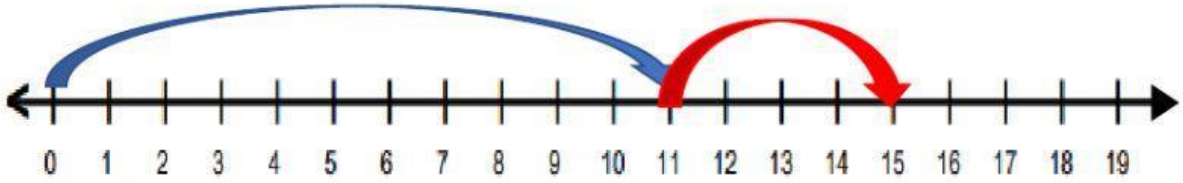
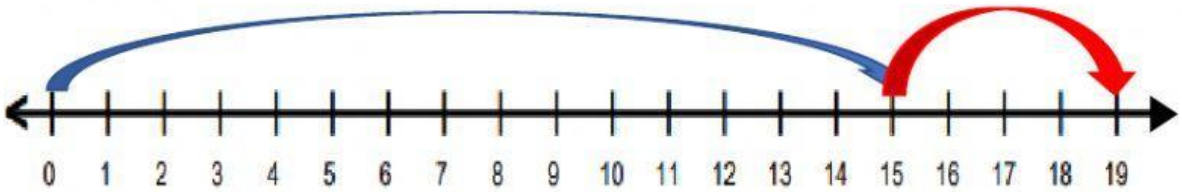
$15 + \square =$