Guía de trabajo "Áreas y Perímetros 5"

Miss Paulina Fernández
Matemática

Objetivo: - Reconocer diámetro y radio
- Desarrollar y aplicar la fórmula del área y perímetro de circulo y circunferencia

I Escribe el valor del diámetro y radio de las siguientes circunferencias

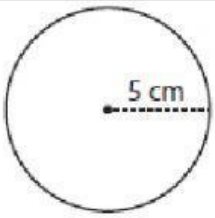 r= d=	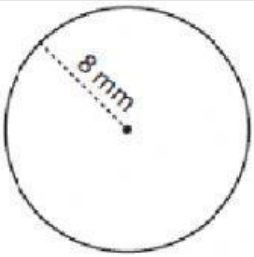 r= d=	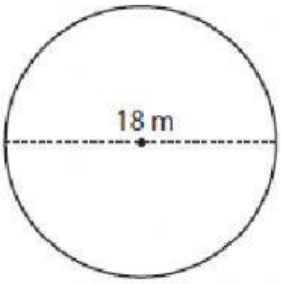 r= d=
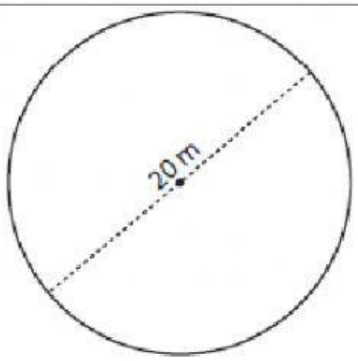 r= d=	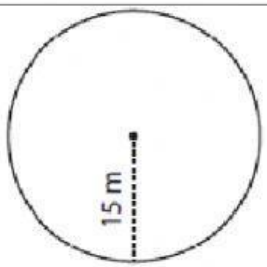 r= d=	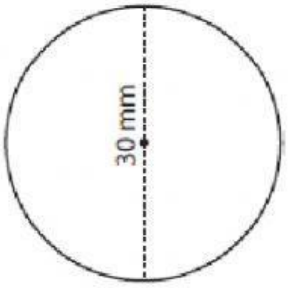 r= d=

II. Arrastra el nombre que corresponde a cada fórmula

$2\pi r$	πr^2

Área Perímetro

III. Calcula el área y perímetro del siguiente círculo

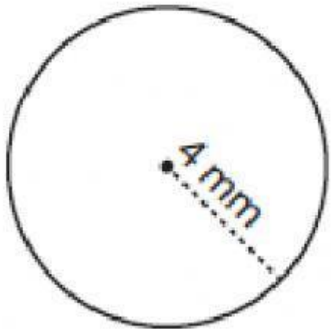

P=

A=