Name:

Practise Questions

Write in figures:
Fifteen thousand and twenty eight.

1. Answr=_____

What is the length of each side of square if its area is $64cm^2$?

2. Answer= _____cm^2

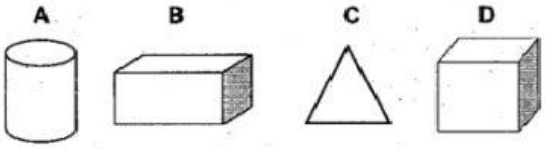

Which of the diagrams above is a cuboid?

3. Answer= _____

If 20% of a number is 15, what is the number?

4. Answer= _____

At a Cricket World Cup match, a vendor sold 250 drinks at $2.00 each. If he purchased them for $1.50 each, what was his profit?

5. Answer= $_____

Mr. Oxley paid 12 monthly installments of $120.00 for a television set. If the down payment for the television was $60.00, how much did he pay for it on hire purchase?

6. Answer=$_____

Round off 654 to the nearest hundred.

7. Answer=_____

Write in figures: fifty six thousand one hundred and four.

8. Answer=_____

What is the smallest number that can be added to 249 to make it exactly divisible by 7?

9. Answer= _____

What is the value of angle 'y'?

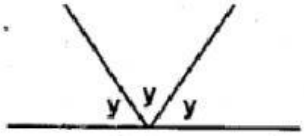

10. Answer= _____

$^3/_5$ of Dad's saving is $9000.00. How much is $^1/_3$ of his total saving?

11. Answer=$_____

A car travelling at 65km/hr reached its destination in 3 hours. What is the total distance of the trip?

12. Answer=_____km

I travel in a car for 60km at a speed of 90km / hr. How long does the journey take?

13. Answer=_____ mins

Arrange the figures 5, 1, 6, 3 to form the largest possible even number.

14. Answer= _____

The containers below contain water.

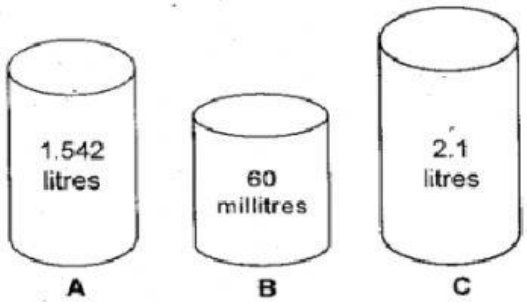

Which container has the least amount of water?

15. Answer_____

What is the average amount in the three containers?

16. Answer_____

What is the difference in the amount in A and C?

17. Answer=_____

In a class there are 30 pupils.
18 like Mathematics
14 like Social Studies
3 like neither
5 like both Mathematics and Social Studies
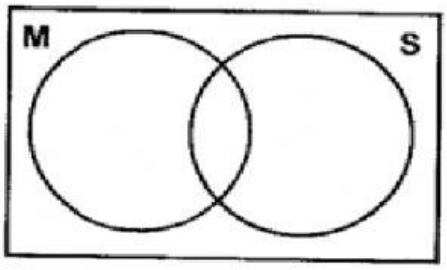
Use the above information to complete the Venn Diagram below.