Name : ..... **Mr / Omar Sholkami** **Alnahyaneia School - Al Ain**

6 faces, 12 edges, 8 vertices

A. B.

C.

0 faces, 0 edges, 0 vertices

A. B.

C. D.

6 faces, 12 edges, 8 vertices

F. G.

H. I. 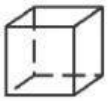

5 faces, 8 edges, 5 vertices

F. G.

H. 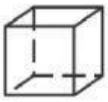

2 faces, 0 edges, 0 vertices

A. 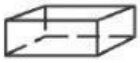 B.

C. D.

5 faces, 8 edges, 5 vertices

F. G.

H. 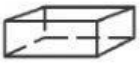 I.

Write the name of the shape.

_____ _____

_____ _____

Complete the sentence.

A cube has 6 faces, _____edges, and 8 vertices.

A cylinder has _____faces, 0 edges, and 0 vertices.

A pyramid has 5 faces, 8 edges, and _____vertices.

Circle the object that is the same shape.

A. B. C.

F. G. H.

Circle the shape that matches the description.

0 faces, 0 edges, 0 vertices

F. G. 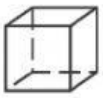 H.

5 faces, 8 edges, 5 vertices

F. G. H.

Circle the name of the shape.

A. cube **B.** rhombus **C.** rectangular prism

F. cone **G.** cylinder **H.** sphere