Sumar

✓ Contarlas y escribir el resultado.

$$\begin{array}{r} 3 \\ +\,2 \\ \hline 5 \end{array}$$

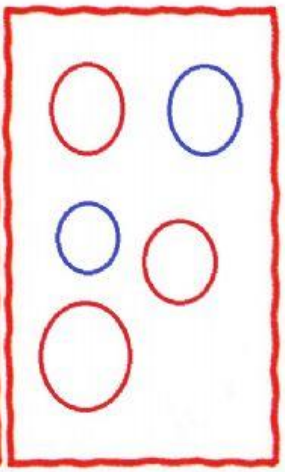

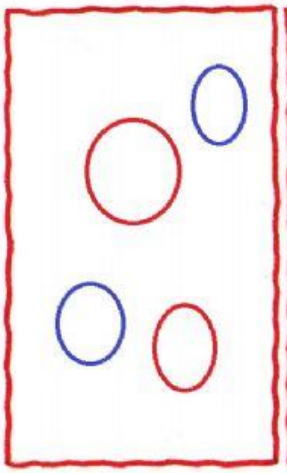

$$\begin{array}{r} 2 \\ +\,2 \\ \hline \end{array}$$

$$\begin{array}{r} 4 \\ +\,2 \\ \hline \end{array}$$

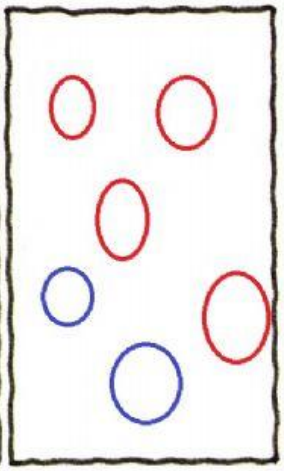

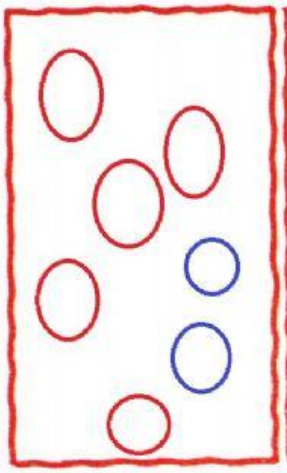

$$\begin{array}{r} 5 \\ +\,2 \\ \hline \end{array}$$

$$\begin{array}{r} 6 \\ +\,2 \\ \hline \end{array}$$

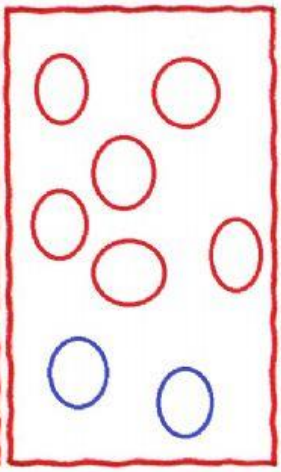

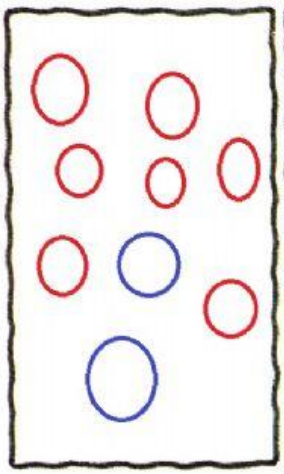

$$\begin{array}{r} 7 \\ +\,2 \\ \hline \end{array}$$