PRISMS & PYRAMIDS

Label each shape.

_____



_____

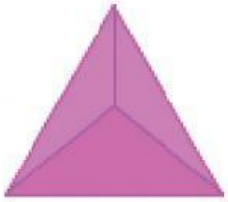

_____



_____

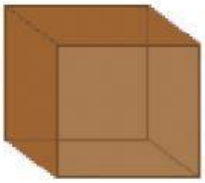

_____



_____

_____

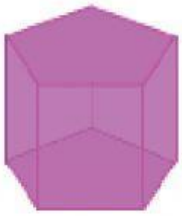

_____

_____

_____

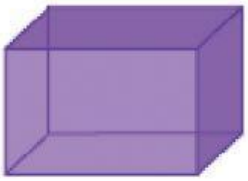

_____

_____