ÁREAS Y PERÍMETROS DE LOS PARALELOGRAMOS

Selecciona el área y el perímetro correcto de cada figura



A= 54cm^2 A= 63cm^2 A= 81cm^2 A= 56cm^2

P= 36cm P= 34cm P= 18cm P= 56cm

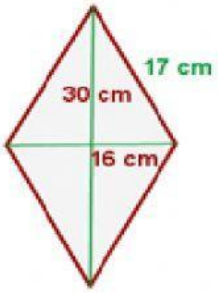

A= 220cm^2 A= 240cm^2 A= 230cm^2 A= 206cm^2

P= 60cm P= 36cm P= 63cm P= 68cm

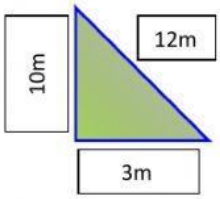

A= 36m^2 A= 30m^2 A= 17m^2 A= 15m^2

P= 22m P= 24m P= 23m P= 25m

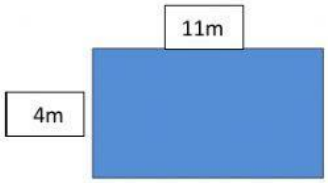

A= 40m^2 A= 44m^2 A= 42m^2 A= 45m^2

P= 30m P= 33m P= 15m P= 32m

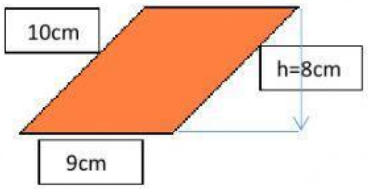

A= 70cm^2 A= 72cm^2 A= 81cm^2 A= 80cm^2

P= 38m P= 39cm P= 37cm P= 38cm

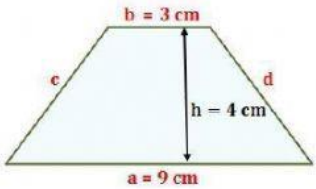

c=d=5cm

A= 24cm^2 A= 22cm^2 A= 21cm^2 A= 25cm^2

P= 20cm P= 23cm P= 22cm P= 24cm