Name : _____ Score : _____

Identifying Polygons

Write **polygon** or **not a polygon**.

1) 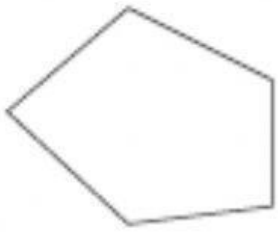

_____

2)

_____

3) 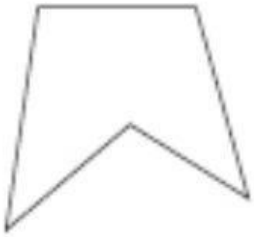

_____

4)

_____

5)

_____

6) 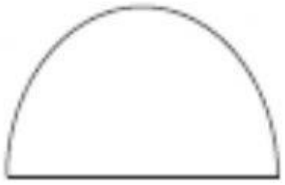

_____

7) 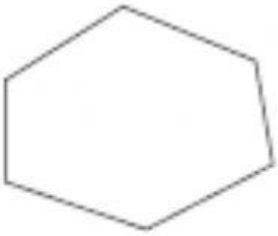

_____

8) 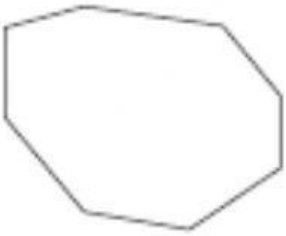

_____

9) 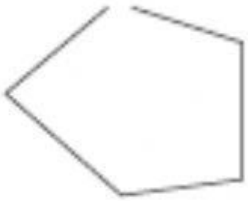

_____

10) 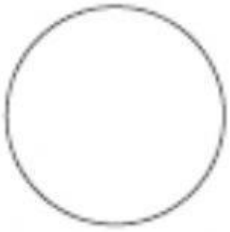

_____

11) 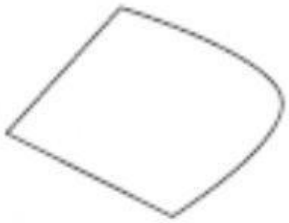

_____

12) 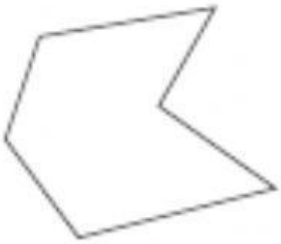

_____