Rellena los cuadros con los números que faltan.

14	15		17
	25	26	

22			25
	27		

5		7
	9	
	12	

	20	
	23	
25		

COMPARA LOS NÚMEROS Y ESCRIBE <, > O = EN EL CUADRO.



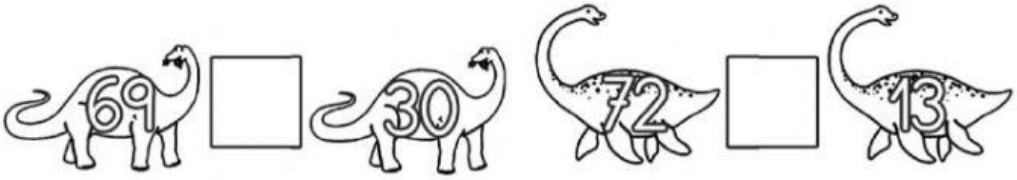





Arcoíris del 1 al 10

___	+	___	= 10	___	+	___	= 10
___	+	___	= 10	___	+	___	= 10
___	+	___	= 10	___	+	___	= 10
___	+	___	= 10	___	+	___	= 10
___	+	___	= 10	___	+	___	= 10
___	+	___	= 10	___	+	___	= 10