RECTAS Y ÁNGULOS - TEST

1. ¿Cuántos segmentos forman cada figura?

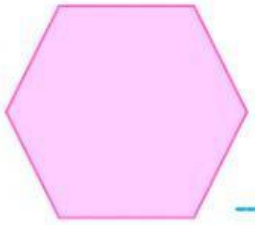



2. Escribe paralelas o secantes.

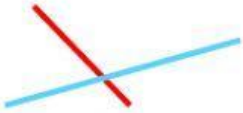



3. Observa el plano y escribe.

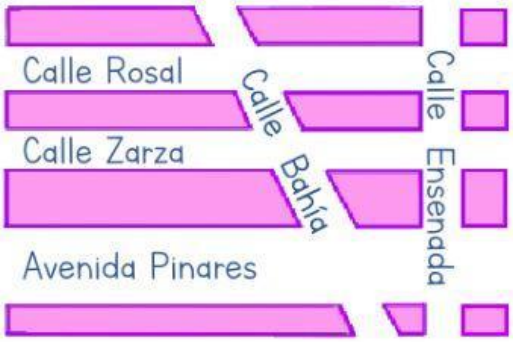

- Las calles paralelas a la calle Rosal.

  _____

- Las calles secantes a la calle Zarza.

  _____

- ¿Cómo son esas calles entre sí?

  _____

4. Escribe "lado" o "vértice" donde corresponda

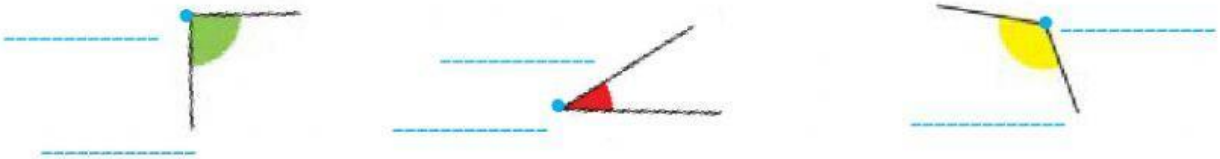

5. Averigua de que tipo son estos ángulos con tu escuadra (o la esquina de un folio) y escríbelo.

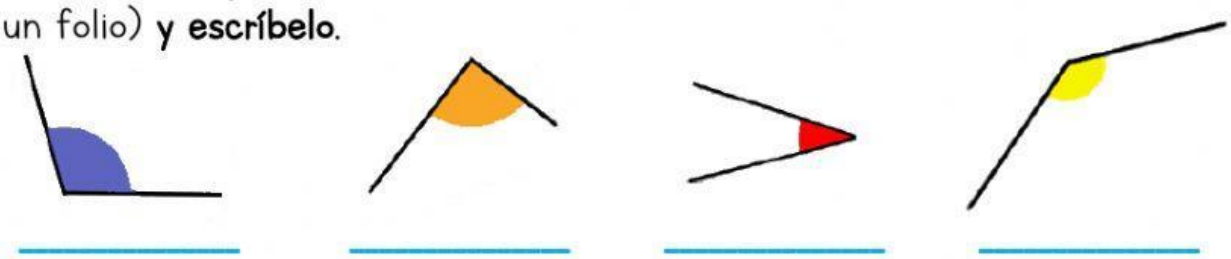

6. Selecciona las rectas que sean perpendiculares.



7. Relaciona los ángulos con su medida. Escribe de qué tipo son.

120º 20º 50º

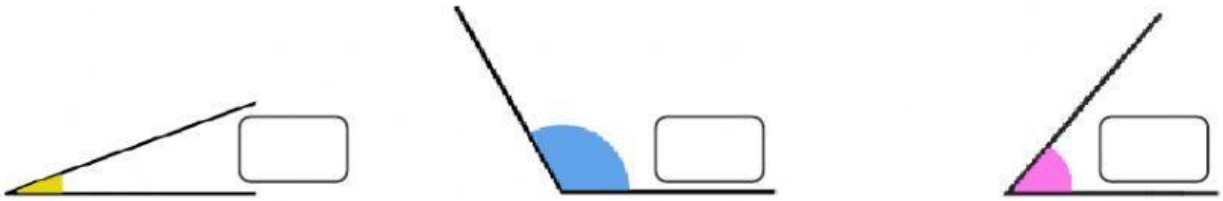

8. Escribe consecutivos o adyacentes.