Individual Task - 4 (04.06.2020) Classify Triangles (on LMS).

Instructions: Complete all the tasks.

Post your answers on LMS.

Answer the question.

Identifying Triangles

Sides - Numerals: S1

Identify each triangle based on sides. (Equilateral, Isosceles or Scalene)

1)

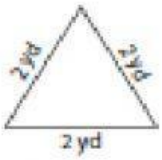

Equilateral triangle

2)

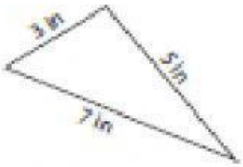

3)

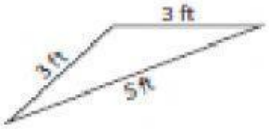

4)

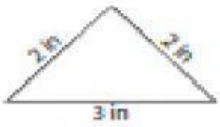

5)

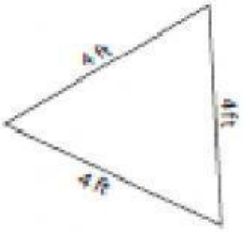

6)

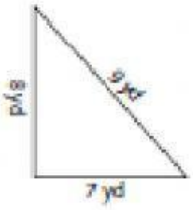

7)

8)

9)

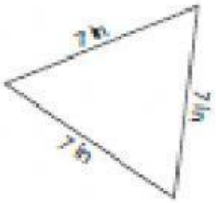

10)

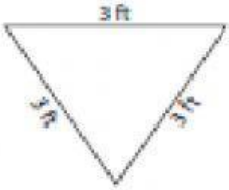

11)

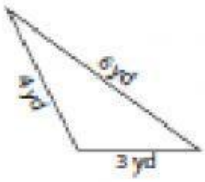
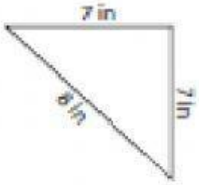
12)